S ICM INSAN CENDEKIA MADANI	Mixed Number & More About Fraction.	Name :
		Class :
		Teacher :
		Date :

		Marks:	Score:
☐ Pre-assessment	☐ Individual guided practice	23	
☐ Independent/ fluency practice	✓ Assessment		

Answer the following questions clearly and correctly!

1. Write the missing numbers. [2]

a.

☐ wholes ☐ quarters

☐ + ☐/4 = ☐

b.



☐ wholes ☐ thirds

☐ + ☐/3 = ☐

2. Write the mixed numbers for the shaded part.

a. ☐ [1]

b. 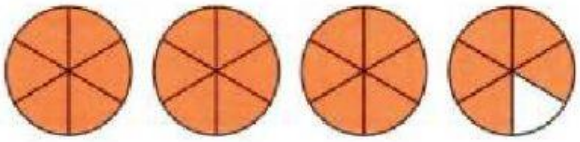 ☐ [1]

LIVEWORKSHEETS

3. Change $\frac{25}{3}$ to a mixed number. [1]

4. Write the mixed numbers to the correct positions on the number line. [5]

a.

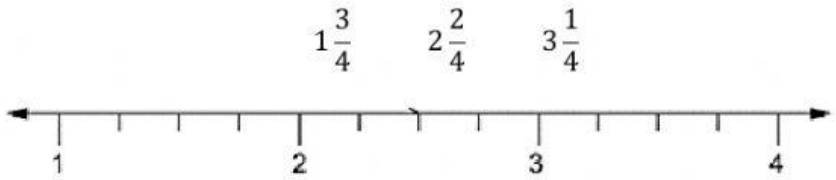

b.

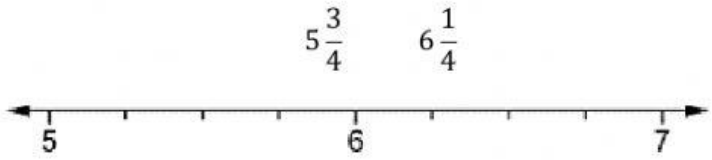

5. Complete this fraction of set. [2]

a.



$\frac{3}{4}$ *of* 12 *is*

b.

$\frac{2}{3}$ *of* 24 *is*

6. Show how you find your answer. [4]

a.

$\frac{3}{6}$ *of* 12 *is* ...

b.

$\frac{2}{3}$ *of* 12 *is* ...

c.

$\frac{8}{10}$ *of* 80 *is* ...

d.

$\frac{3}{5}$ *of* 20 *is* ...

LIVEWORKSHEETS

7. Write the missing numbers to show equivalent fractions. [4]

(a) $\frac{1}{3} = \frac{7}{\square}$ (×7)

(b) $\frac{1}{4} = \frac{4}{\square}$ (×4)

(c) $\frac{1}{5} = \frac{\square}{\square}$ (×6)

(d) $\frac{1}{6} = \frac{\square}{\square}$ (×3)

8. The number of boxes and the number of tarts are in proportion. [3]

Complete the table.

Number of boxes	Number of tarts
1	6
2	☐
☐	☐

LIVEWORKSHEETS