IL PERIMETRO

Calcola il PERIMETRO dei seguenti poligoni. Osserva l'esempio.



P = 14 ⊢⊣

P = ... ⊢⊣



P = ... ⊢⊣



P = ... ⊢⊣



P = ... ⊢⊣



P = ... ⊢⊣

LIVEWORKSHEETS