HWOO - Math Assessment- Week 3

1.

A fruit seller sold some fruit on Sunday. He recorded the number of pieces he sold in the bar graph below. Study the bar graph carefully and fill in each blank with the correct answer.

Fruit Sold on Sunday

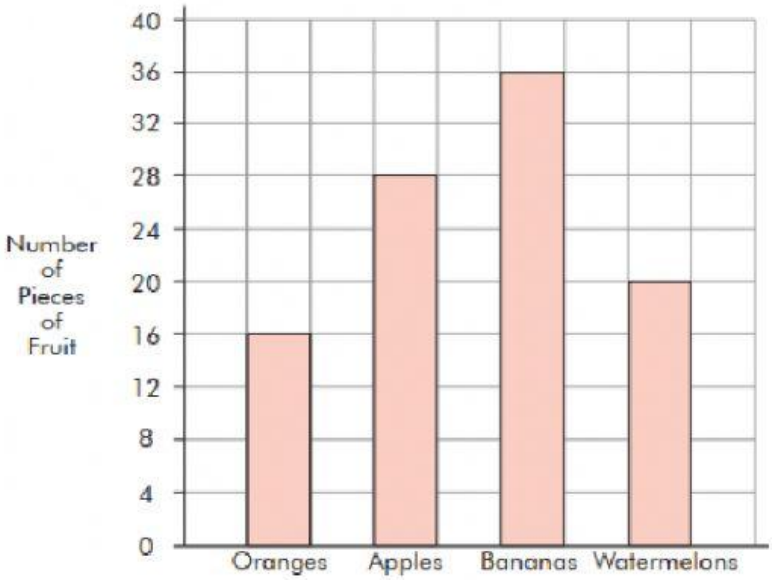

(a) _____ apples were sold.

(b) He sold the largest number of _____.

(c) He sold the smallest number of _____.

(d) He sold _____ more bananas than oranges.

(e) He sold _____ more apples than watermelons.

(f) The total number of fruit sold on that Sunday was _____.

LIVEWORKSHEETS

2.

This bar graph shows the number of eggs sold by Mrs Lin from Monday to Friday.

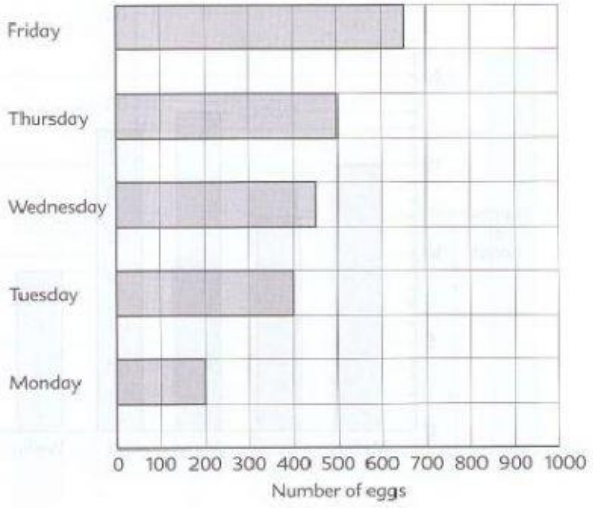

Study the graph and fill in the blanks.

(a) Mrs Lin sold _____ eggs on Friday.

(b) She sold _____ more eggs on Friday than on Thursday.

(c) She sold 450 eggs on _____.

(d) She sold twice as many eggs on Tuesday as on _____.

(e) *She sold _____ eggs altogether on the five days.*

LIVEWORKSHEETS

3.

Ana and her sister went to a park. They drew a bar graph of what they saw at the park. Study the bar graph carefully and fill in each blank with the correct answer.

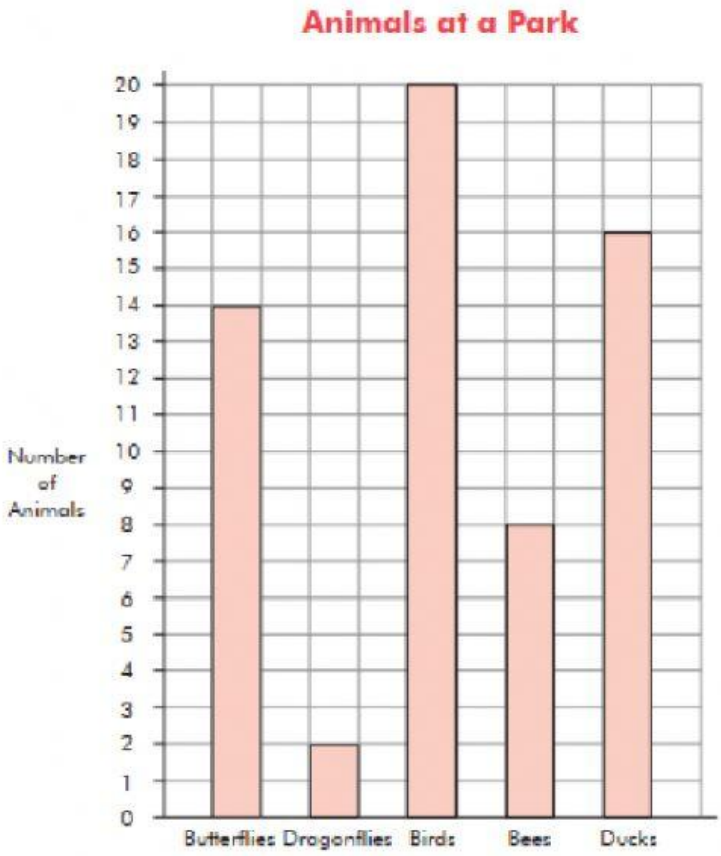

(a) They saw _____ birds.

(b) There were _____ more ducks than butterflies.

(c) There were _____ fewer bees than birds.

(d) They saw the least number of _____.

(e) They saw the most number of _____.

(f) They saw _____ animals altogether at the park.

LIVEWORKSHEETS

4.

Jorge saved some money in a week. He recorded the amount of money he saved in the bar graph below. Study the bar graph carefully and fill in each blank with the correct answer.

Jorge's Savings in a Week

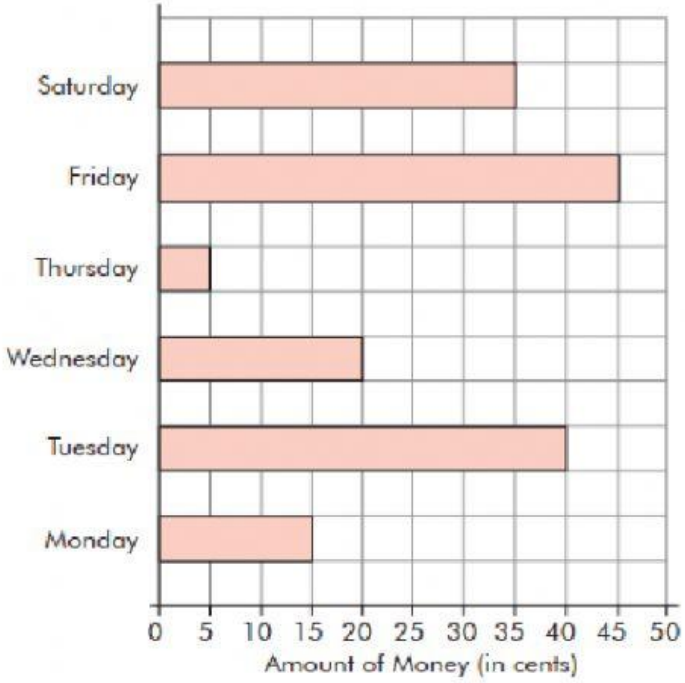

(a) He saved _____ cents on Friday.

(b) He saved _____ cents more on Tuesday than on Monday.

(c) He saved 7 times more on Saturday than on _____.

(d) He saved $_____ altogether in a week.

(e) Jorge needs $10 to buy a present for his mother.

He needs to save $_____ more.

LIVEWORKSHEETS

5.

A group of children made this picture graph to show the times at which they get up in the morning.

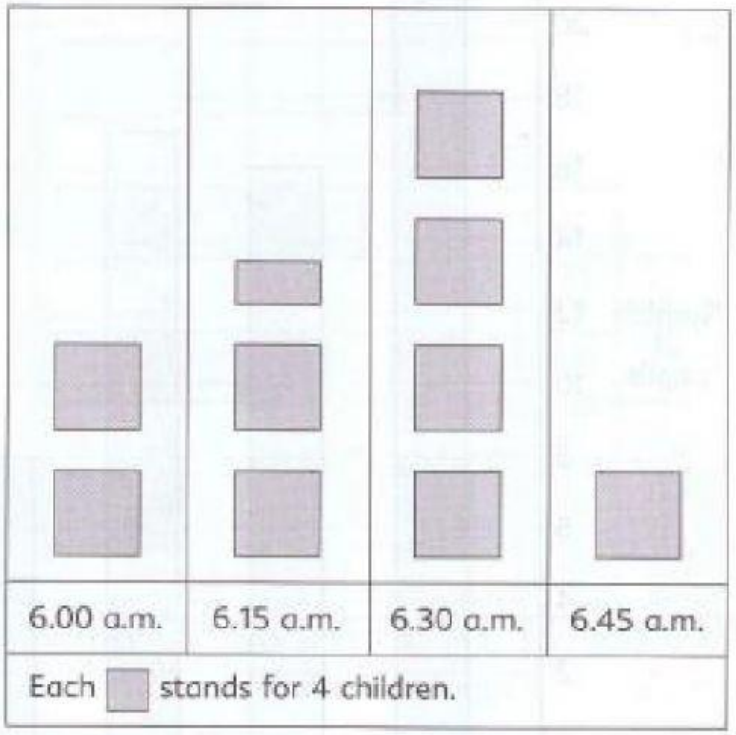

Study the graph and fill in the blanks.

(a) _____ children get up at 6.15 a.m.

(b) 4 children get up at _____.

(c) _____ more children get up at 6.00 a.m. than at 6.45 a.m.

(d) The greatest number of children get up at _____.

(e) _____ children get up before 6.30 a.m.

LIVEWORKSHEETS