درس الاقواس والاوتار
(١)

اذا كان mAB=78 في الشكل اعلاه،فأوجد mCD.

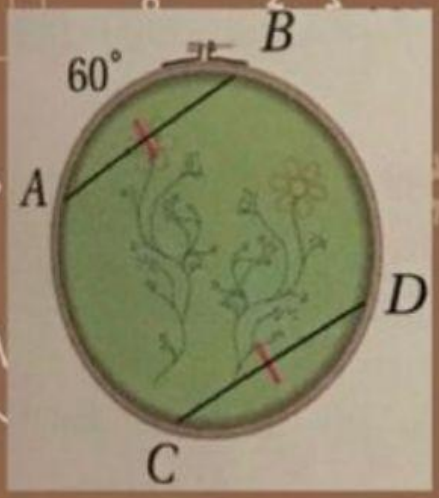

AB=79 AB=78 AB=65

في W ،اذا كان RS=TV، فاوجد RS

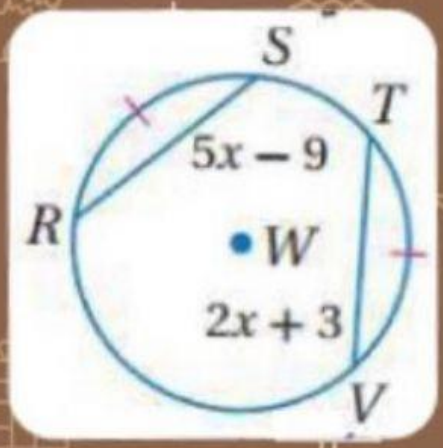

RS=11 RS=14 RS=24

اوجد PR في S

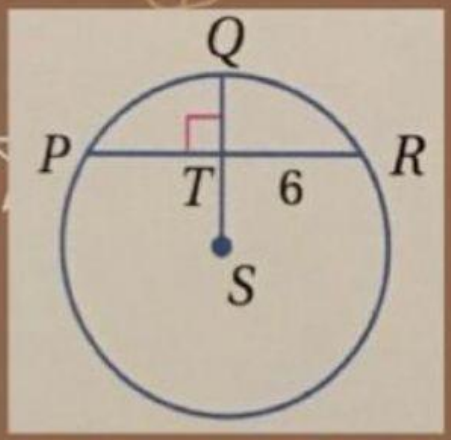

PR=10 PR=9 PR=12

LIVEWORKSHEETS