LIVE WORK SHEETS

السؤال الأول: ما هو العدد المناسب للصورة

	3 5 2 1
	3 5 7 4
	9 6 7 8
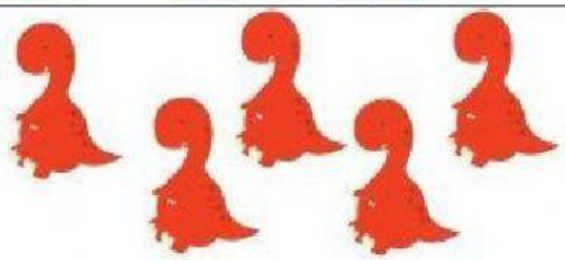	6 7 5 4
	2 4 5 3
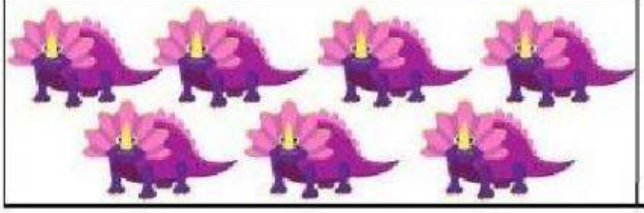	7 6 9 8

LIVEWORKSHEETS

السؤال الثاني: ضع الاسم بجانب الصورة

cow | horse | dog | donkey | duck | giraffe

LIVEWORKSHEETS

السؤال الثالث رتب الأعداد التالية تصاعدياً

5 3 6 9 2 1 7 4 8

السؤال الرابع: صل المجسم مع اسمه



أسطوانة



مخروط

مكعب

هرم

LIVEWORKSHEETS