FIGURE SOLIDE E PIANE

1 Scrivi il nome di ciascuna figura.

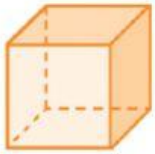

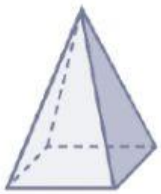

....

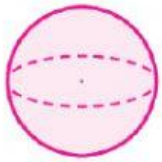

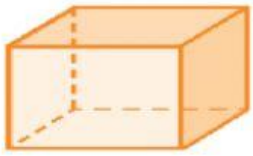

....

2 Osserva le due figure. Conta e completa.

- triangoli .....
- cerchi .....
- quadrati .....
- rettangoli .....
- rombi .....



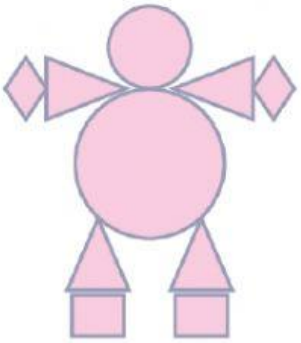

3 Quanti dadi sono serviti per queste lettere?

- ☐ A. 8
- ☐ B. 9
- ☐ C. 10





- ☐ A. 15
- ☐ B. 16
- ☐ C. 17

LIVEWORKSHEETS