The Clock — Half past the hour.

Look at the clock and tell the time. Write two ways of telling the time.



Half past six

6:30



Half past _____



Half past _____



Half past _____



Half past _____



Half past _____

LIVEWORKSHEETS