Name: _____ Date: _____

NAME THE POLYGONS

Drag the names in the box and drop them in the right polygons below. Then write the number of polygon sides in the line provided. Follow the sample given.

rectangle | pentagon | hexagon

heptagon | octagon | nonagon | decagon

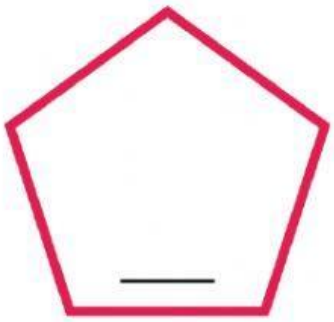



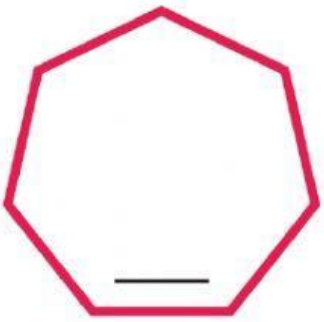

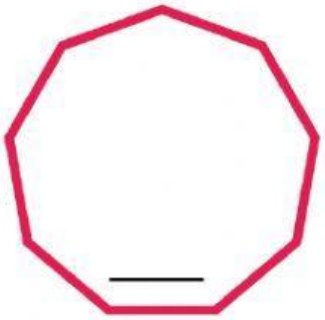

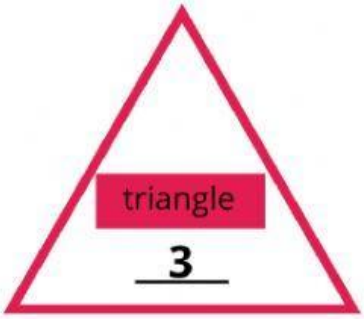

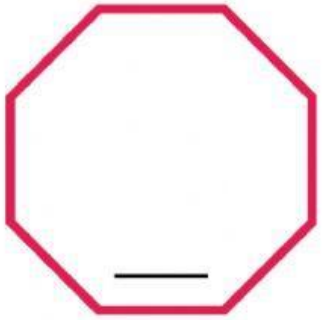

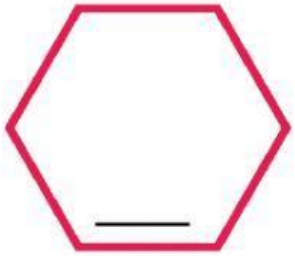

LIVEWORKSHEETS

NAME THAT POLYGON!

Can you name these polygons according to the number of their sides?

Four sides



Five sides

Six sides



Seven sides



Eight sides



Nine sides

LIVEWORKSHEETS

Names of Polygons

Fill in the blank spaces in the table below. The first one has been done for you.

Number of Sides	Polygon Name	Diagram
3	triangle	
4		
5		
6		
7		
8		
9		
10		

LIVEWORKSHEETS