每月评估 1

A 把多的一组涂上红色，把少的一组涂上黄色。 1.1.1 TP1

1

a



b



2

a

b

3

a



b



B 圈出正确的答案。 1.1.2 TP1

1



2

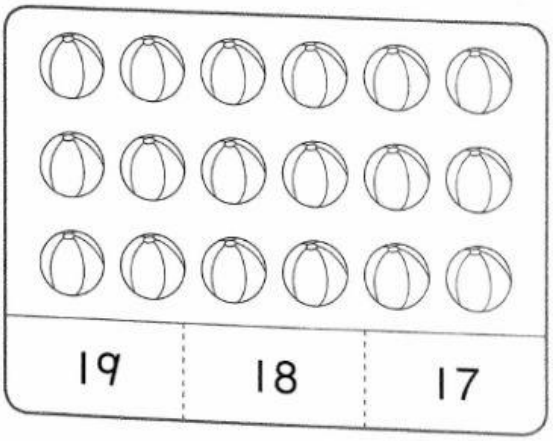

1.1.1, 1.1.2 TP1 讲述任何 100 以内的数目

掌握 / 还未掌握

LIVEWORKSHEETS

〔D〕 圈出正确的答案。 1.1.1 TP1

1

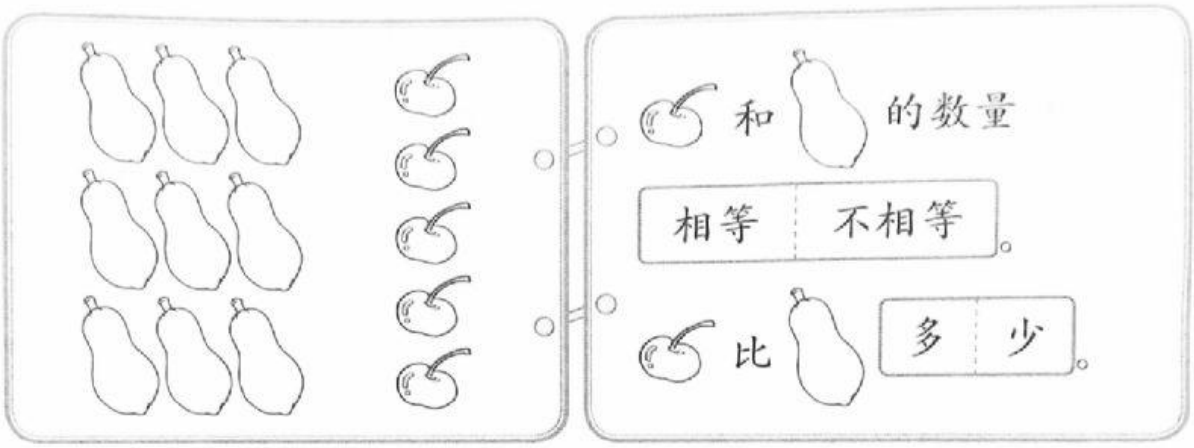

2



LIVEWORKSHEETS

E 填上正确的答案。 1.4.1 TP1

1



2

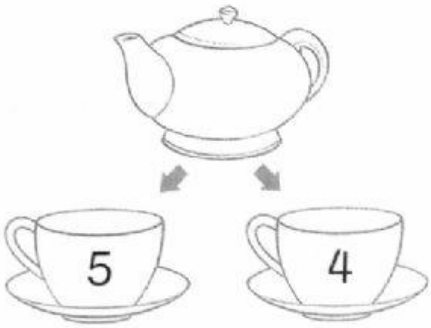

3

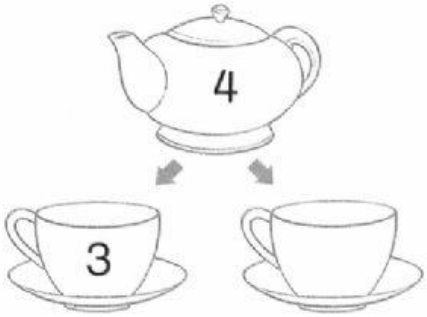

4



LIVEWORKSHEETS

H 连一连。 1.2.2 TP1

1

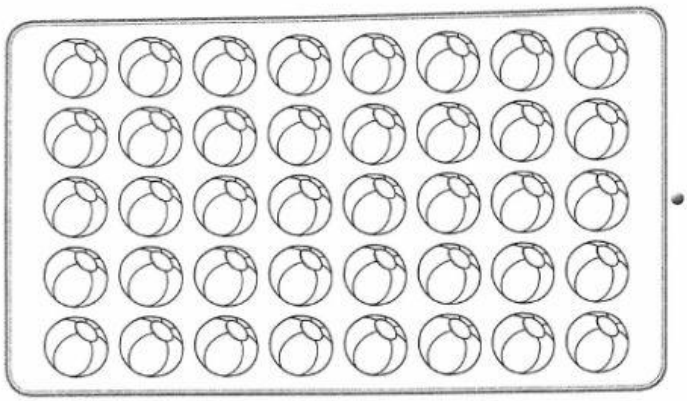

2

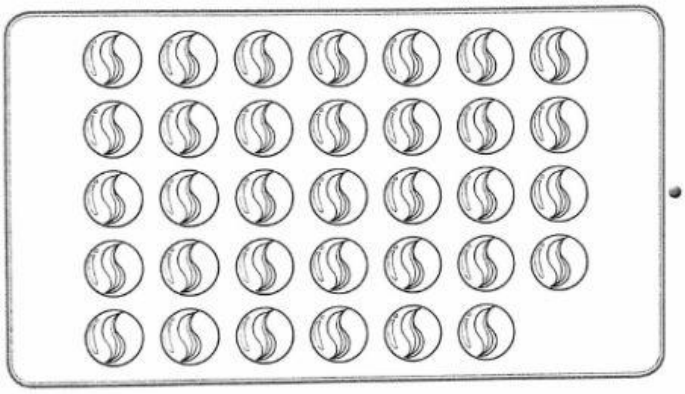

3



I 比一比，把较大的数目圈起来。 1.2.2 TP1

1



2



3



LIVEWORKSHEETS

E 两个两个地数，填一填。 1.5.2 TP3

1 17 → ☐ → 21 → ☐ → 25

2 ☐ → ☐ → 45 → ☐ → 49

3 ☐ → 62 → 60 → ☐ → ☐

LIVEWORKSHEETS

M 完成以下的数轴。 1.5.2 TP3

1

1 2 [ ] 4 [ ] 6 [ ] 8

2

11 12 [ ] [ ] 15 [ ] 17 [ ]

LIVEWORKSHEETS