PRÉ III

UNIDADE ESCOLAR: E. M. BRANCA PEÇANHA FERREIRA	DATA: ____/____/____
PROFESSOR(A):	TURMA:
ALUNO (A):	

1- COMPLETE A SEQUÊNCIA NUMÉRICA ATÉ 9.

0		2		4		6		8	
	1		3		5		7		9
0									



2- PINTE OS QUADRINHOS ABAIXO, DE ACORDO COM O NÚMERO DE ELEMENTOS EM CADA GRUPO.



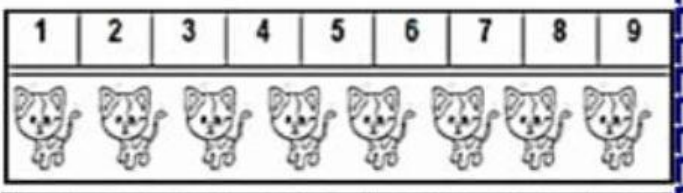

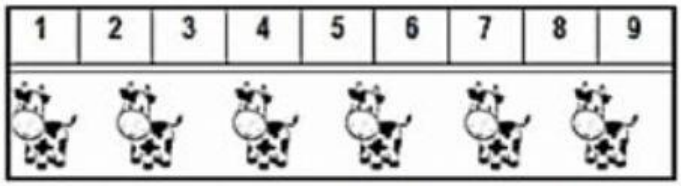



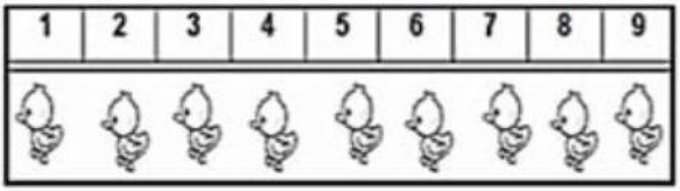

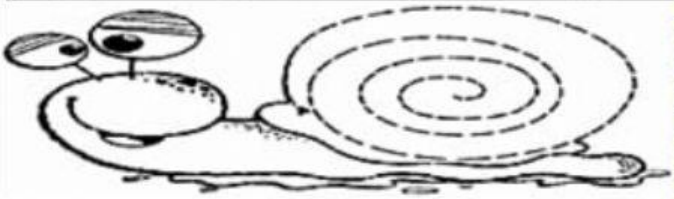

3- NO CONJUNTO ABAIXO, CONTINUE DESENHANDO ATÉ QUE HAJA 9 FLORES.

4- PINTE A CENA EM QUE APARECE APENAS 1 GATO.

LIVEWORKSHEETS