Name: _____ Class: _____

ADDITION

Add the images and draw a line to the total number.

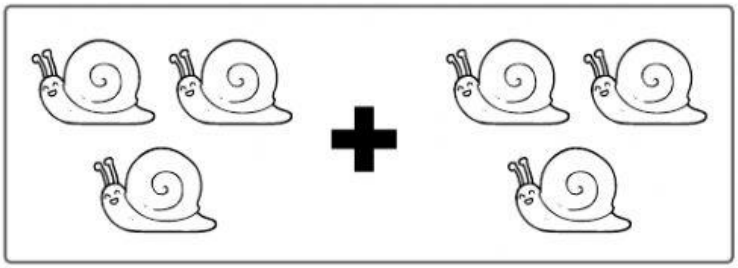

• • 5



• • 6



• • 8

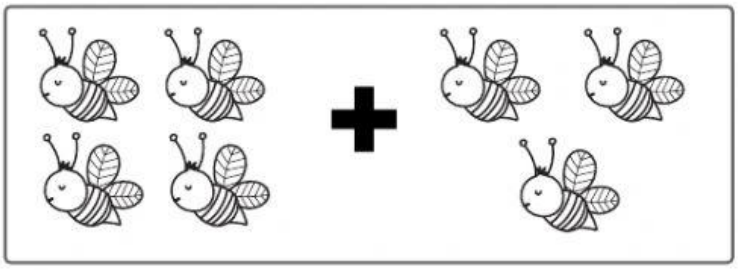

• • 3



• • 7

LIVEWORKSHEETS