Name : _____

Score : _____

Multiplication Using Pictures

Sheet

1)

How many neckties will 4 such stands hold?

_____

2)

How many petals will 8 such flowers have?

_____

3)

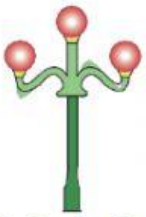

How many light bulbs will 9 such streetlamps have?

_____

4)

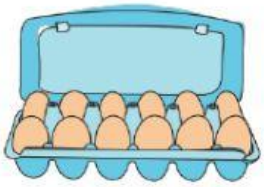

How many eggs will 2 such egg crates contain?

_____

5)

How many drawers will 6 such chests have?

_____

6)

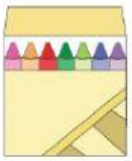

How many crayons will 5 such boxes contain?

_____

7)

How many cookies will 4 such plates contain?

_____

8)

How many spoons will 5 such stands hold?

_____

LIVEWORKSHEETS