Multiplication groups

Look at the pictures and fill in the blanks

_____ groups of _____

_____ × _____ = _____

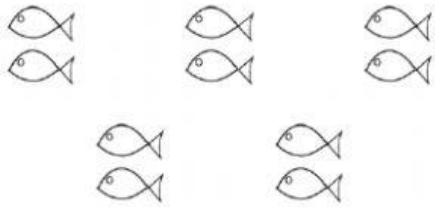

_____ groups of _____

_____ × _____ = _____



_____ groups of _____

_____ × _____ = _____

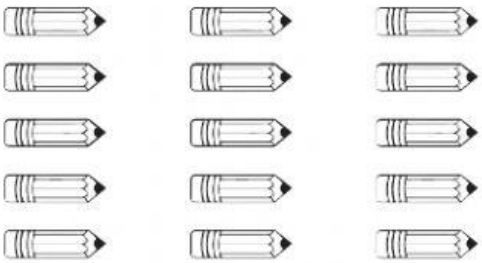

_____ groups of _____

_____ × _____ = _____

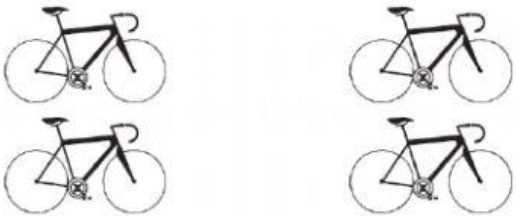

_____ groups of _____

_____ × _____ = _____



_____ groups of _____

_____ × _____ = _____

AcocadoMY
-It's a place to ace-
LIVEWORKSHEETS