Name: _____

Counting On to 10 Under the Sea

Say the number. Then, count the objects on to find the sum. Write the sum in the box provided.

1.	3	+		=		
2.	5	+		=		
3.	8	+		=		
4.	7	+		=		
5.	4	+		=		
6.	6	+		=		
7.	2	+		=		
8.	9	+		=		
9.	5	+		=		
10.	7	+	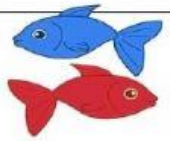	=		

LIVEWORKSHEETS