Nama:_____Tahun:_____

Tarikh :_____

**CABARAN RUANG**

**Selepas pembelajaran ini, murid dapat:**

- Menentukan ruang yang selamat dalam aktiviti fizikal.
- Membezakan pergerakan mengikut ruang.

**Padankan rajah dengan perlakuan yang betul.** SP1.1.1, 2.1.1, 5.1.5

1.

2.

3.

4. 

5.

6.

7.

8. 

Berlari

Berjalan

Melompat

Merangkak

Menyusup

Mengimbang

Mendaki tangga

Menggelongsor

LIVEWORKSHEETS

## Uji Saya

1. Di ruang manakah kamu senang bergerak? Mengapa?



2. Padankan pergerakan.

(a) LURUS

(b) SPIRAL

(c) ZIG-ZAG

(d) BERLENGKOK

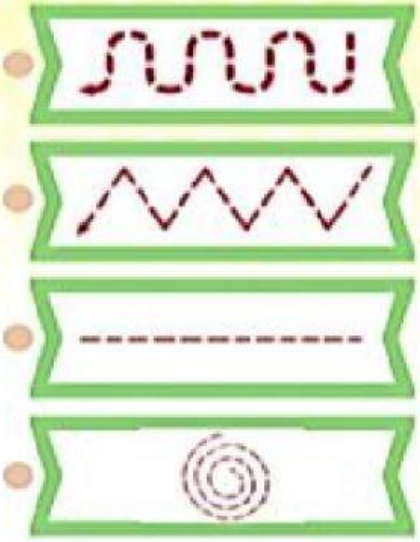

LIVEWORKSHEETS