Name:

Grade & Section:

Date:

Time:

hunterswoodsph

# Area of a Parallelogram

Find the area of each parallelogram below.

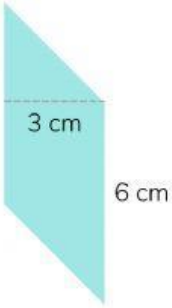


AREA: _____ $cm^2$




AREA: _____ $mm^2$

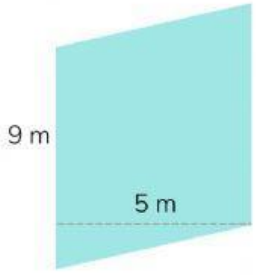


AREA: _____ $m^2$

AREA: _____ $mm^2$

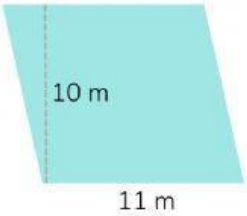


AREA: _____ $m^2$

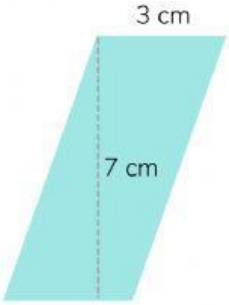


AREA: _____ $cm^2$

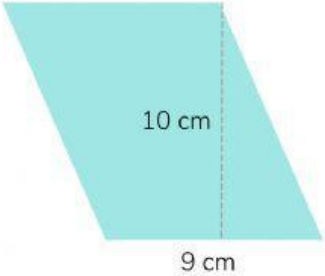


AREA: _____ $cm^2$

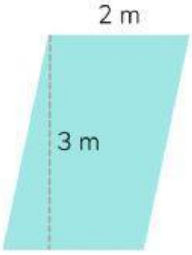


AREA: _____ $m^2$

AREA: _____ $mm^2$

LIVEWORKSHEETS