MIRA EL VIDEO

AYUDEMOS A SAURI A HACER ESTAS RESTAS:



$$\begin{array}{r} \square \\ - \ \square \\ \hline \square \end{array}$$



$$\begin{array}{r} \square \\ - \ \square \\ \hline \square \end{array}$$



$$\begin{array}{r} \square \\ -\ \square \\ \hline \square \end{array}$$



$$\begin{array}{r} \square \\ -\ \square \\ \hline \square \end{array}$$

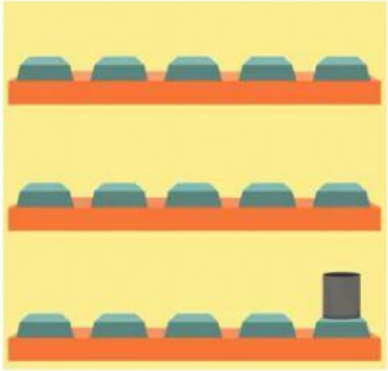

$$\begin{array}{r} \square \\ -\ \square \\ \hline \square \end{array}$$