Square Numbers

Example:

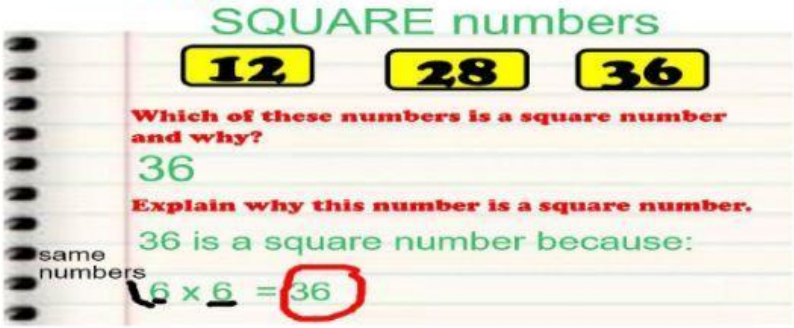

17 | 24 | 32 | 36

Which of these numbers are a Square Number?

=

This is because....

x =

LIVEWORKSHEETS

Square Numbers

Example:

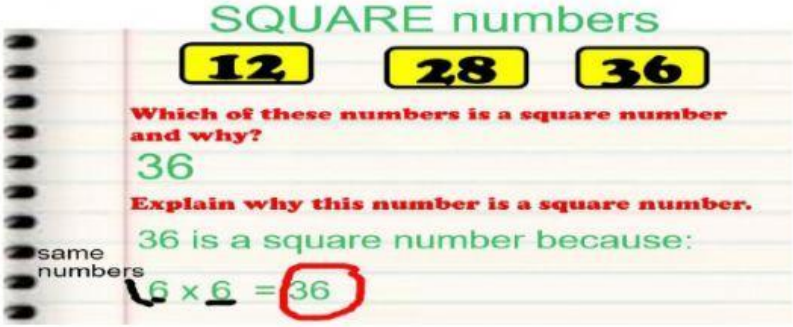

5 | 9 | 12 | 5

Which of these numbers are a Square Number?

=

This is because....

x =

LIVEWORKSHEETS

Square Numbers

Example:

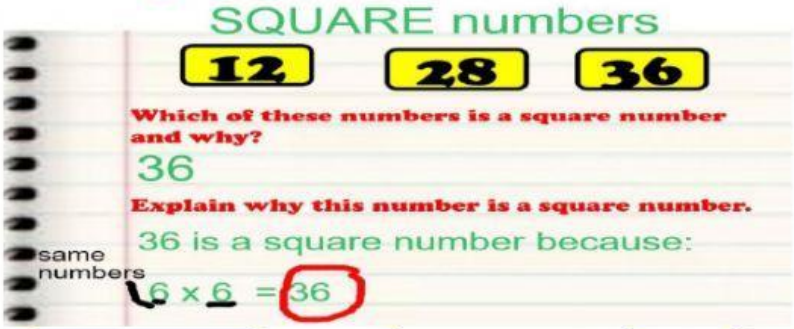

13 15 16 18

Which of these numbers are a Square Number?

=

This is because...

x =

LIVEWORKSHEETS

Square Numbers

$2^2 = 2 \times 2 = 4$

$4^2 = \square \times \square = \square$

$5^2 = \square \times \square = \square$

$6^2 = \square \times \square = \square$

$10^2 = \square \times \square = \square$

LIVEWORKSHEETS

Square Numbers

LIVEWORKSHEETS