Name -			
Phase 1– Foundation Numeracy **Class Worksheet -24**			
Stage-	Beginner	Grade-	1
Conceptual Area -	Measurement	Topic-	Comparing and measuring length

A. Look at the pictures. Colour the long picture and circle the short one.

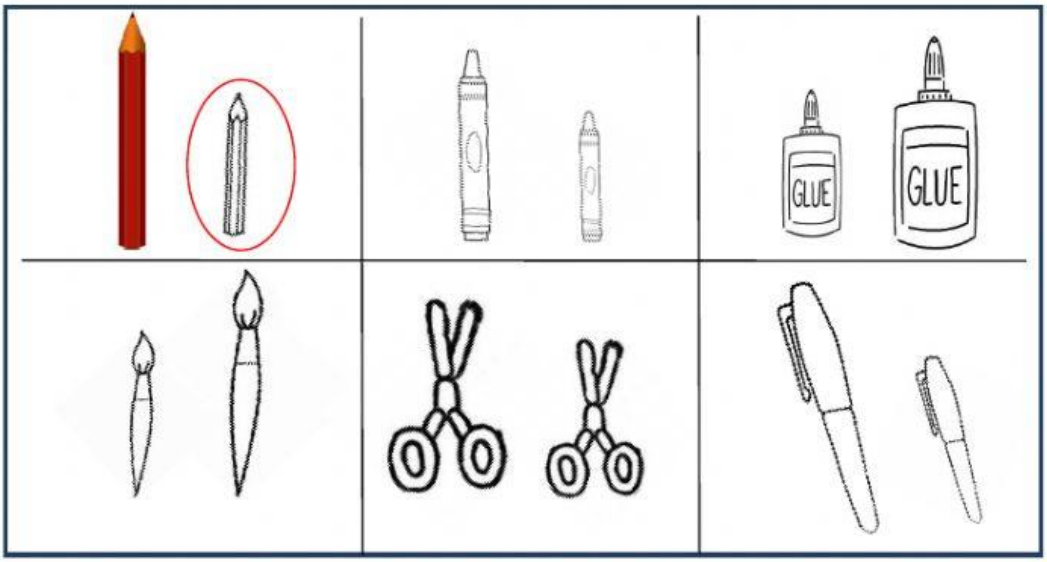

B. Draw a tree **taller** than the one given below.



LIVEWORKSHEETS

LEARNING LINKS FOUNDATION

WORKSHEET

C. Draw a glass **shorter** than the one given below.



D. Draw a pencil longer than the given pencil.



E. Colour the **tallest animal yellow**and **shortest animal green**. Then fill in the blanks given below.

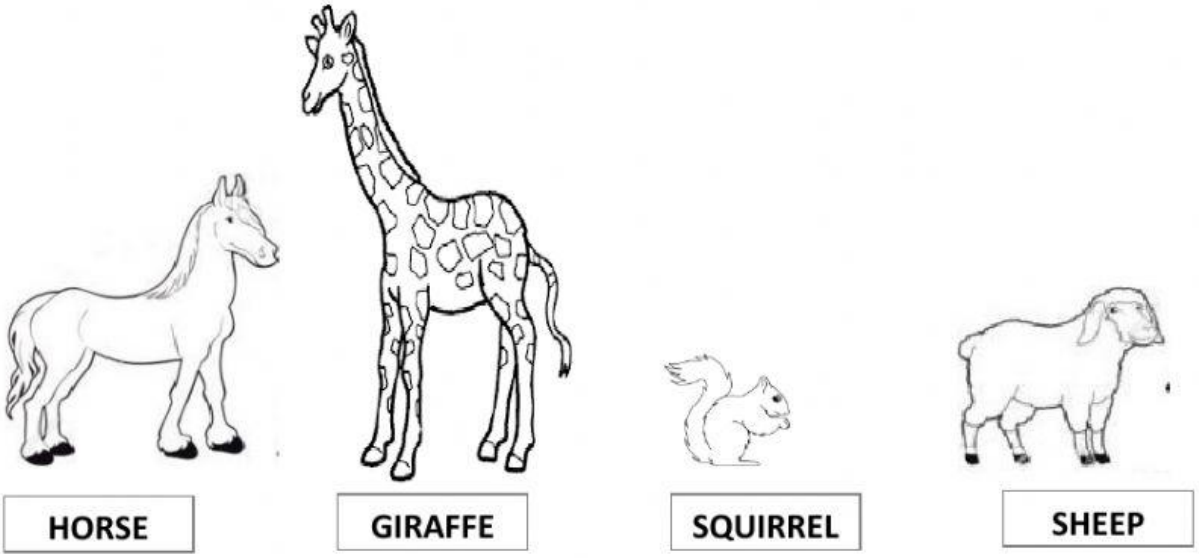

a. _____ is the tallest animal.

b. _____ is the shortest animal

c. Which is taller? Horse or Sheep _____ is taller.

d. Which is shorter? Squirrelor Sheep. _____ is shorter.

e. The horse is taller than _____ and _____.

f. The squirrel is shorter than _____ and _____.

 ©Learning Links Foundation

LIVEWORKSHEETS