POINT FORTIN ROMAN CATHOLIC SCHOOL

EASTER TERM TEST

STANDARD TWO

MATHEMATICS

Name_____



Instructions

Read all instructions Carefully.

Answer all questions in this booklet.

Show all working. Marks will be given for correct steps taken.

LIVEWORKSHEETS

No.	Test Items
1.	Write the numeral for the number shown in the place value chart. 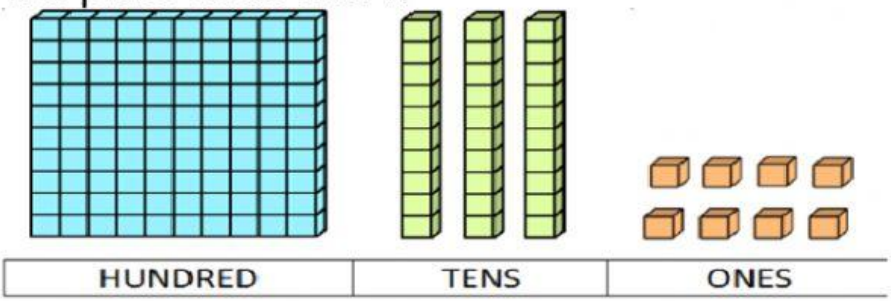 Answer _____ 1 mark
2.	Write in Words: a. 1649_____ b. 836_____ 2 marks
3.	Write the Numerals for: a. One Thousand four hundred and thirteen. _____ b. Six Hundred and fifty-seven. _____ 2 marks
4.	Round off to the nearest 100 a. 246 _____ b. 579 _____ c. 781 _____ 3 marks

LIVEWORKSHEETS

5.	Insert the greater than > or less than < symbol. a. 56 __ 68 b. 175 __ 287 c. 1884 __1025 3 marks
6.	Fill in the blanks to complete the pattern below: a. 128, 132, __, 140, 144. b. 550, 555, __, 565,570, __ 3 marks
7.	Arrange in ascending order a. 46, 63, 91, 74, 47 _____ b. 145, 210, 168, 324, 300 _____ 2 marks
8.	Arrange in descending order. a. 57, 88, 61, 90, 75 _____ b. 876, 432, 781, 592, 340 _____ 2 marks

LIVEWORKSHEETS

9.	Wendy reads 501 pages of a book on Saturday. She reads 239 pages of the book on Sunday. How many pages did Wendy read altogether? Answer_____ 1mark
10.	Jay has a collection of 1458 football card. His brother has 376 football cards. How many more football cards does Jay have than his brother? Answer_____ 1mark
11.	What is the shaded area of the shape? 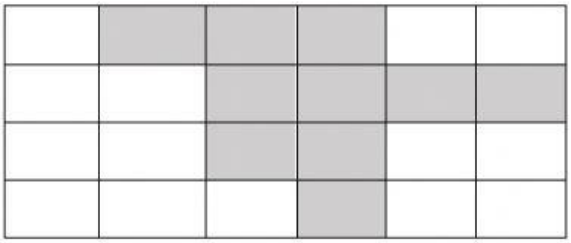 Answer_____ 1 mark

LIVEWORKSHEETS

12.	Complete these. 256 − 107 318 + 130 316 + 458 492 − 365 592 − 285 109 + 789 603 + 197 370 − 302 8 marks
13.	Choose the correct shape from the box to complete the pattern below. 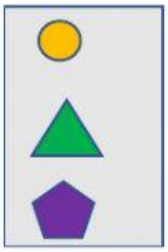 ___ ___ 1 mark
14.	**Imagine these objects are their usual size and match them to the most suitable length.** **fly** **car** **pencil** **5 m** **6 mm** **12 cm** _____ _____ _____ **3 marks**

LIVEWORKSHEETS

15.	Convert to centimeters. a. 4m = ____cm _____ b. 9m 99cm = ____cm _____ **2 marks**
16.	Choose the most appropriate unit to measure each length. Write **centimetre** or **metre**. a. The distance from your class to the cafeteria. _____ b. The width of your notebook. _____ 2 marks
17.	Fill in the blank with the missing value? (3000) + (____)+ (50) + (6) = 3856 Answer_____ 1 mark

LIVEWORKSHEETS

18. Write the **name** of the 3-Dimensional Shape below. Then label the diagram with the number of **faces, edges** and **vertices/corners**.

a. Name: _____

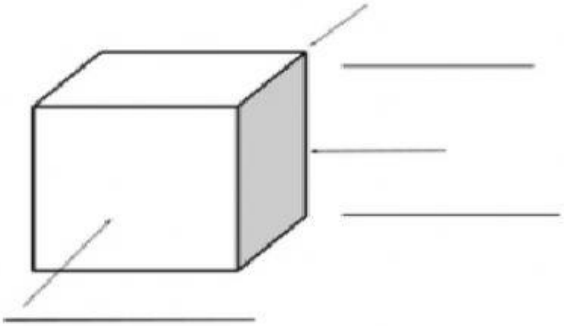

b.

c.

d.

4 marks

19. Complete the tally chart.

FAVOURITE COLOURS OF STUDENTS IN STANDARD 2		
Colour	Tally	Total
Red	𝍸 𝍸 ||	
Blue		4
Purple	𝍸	

a. How many persons like purple?

_____

b. How many more persons like red than blue?

_____

c. How many persons took the survey?

_____

4 marks

LIVEWORKSHEETS

20.

Mode of transport	Number of students
Bus	☺☺☺☺☺☺☺
Car	☺☺☺☺
Walking	☺☺☺☺☺☺
Bycycle	☺☺☺
Key : ☺ Represents 4 children	

a. How many children walks to school?

_____

b. What is the most used mode of transportation?

_____

c. What is the least used mode of transportation?

_____

d. How many more children come to school by bus than by bicycle?

_____

4 marks

Total 50 marks

End of Test

LIVEWORKSHEETS