ECI JOÃO RIBEIRO
ATIVIDADE DE MATEMÁTICA
ÂNGULOS NOTAVEIS

ALUNO:

01-ENCONTRE O VALOR DE X EM CADA CASO.

ÂNGULOS NOTÁVEIS

	$30^{\underline{o}}$	$45^{\underline{o}}$	$60^{\underline{o}}$
SENO	$\frac{1}{2}$	$\frac{\sqrt{2}}{2}$	$\frac{\sqrt{3}}{2}$
COSSENO	$\frac{\sqrt{3}}{2}$	$\frac{\sqrt{2}}{2}$	$\frac{1}{2}$
TANGENTE	$\frac{\sqrt{3}}{3}$	1	$\sqrt{3}$

a)

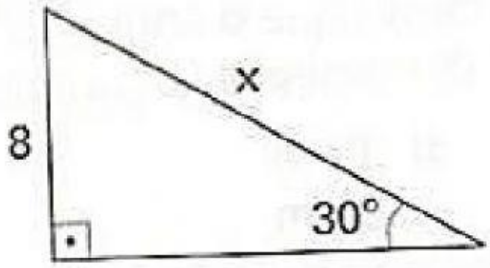

b)

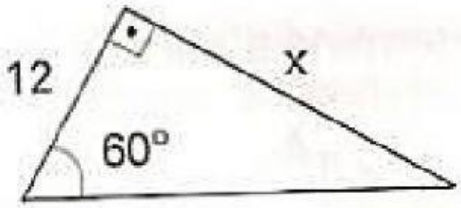

c)

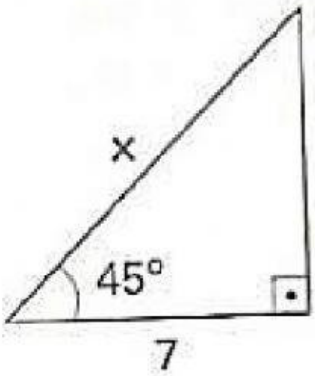

d)

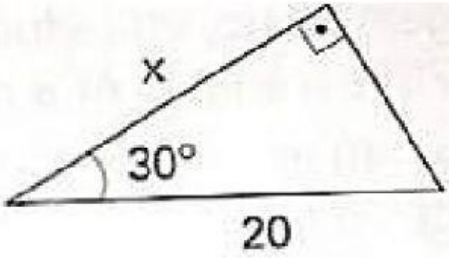

RESPOSTAS

a)

b)

c)

d)

LIVEWORKSHEETS