TOTAL SURFACE AREA

Find the surface area of each cylinder. (use π = 3.14)

1)

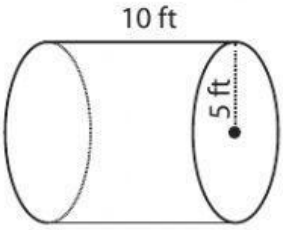

Surface Area = _____

2)

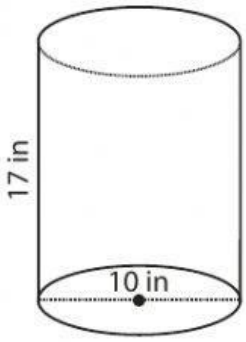

Surface Area = _____

3)

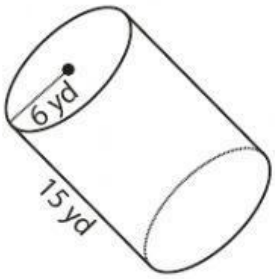

Surface Area = _____

4)

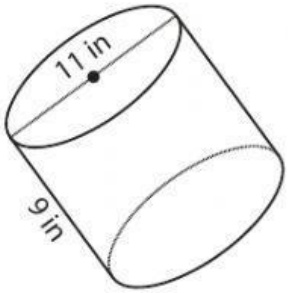

Surface Area = _____

5)

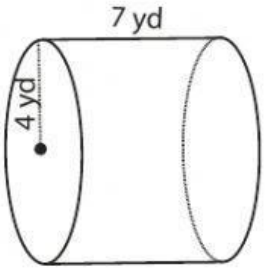

Surface Area = _____

6)

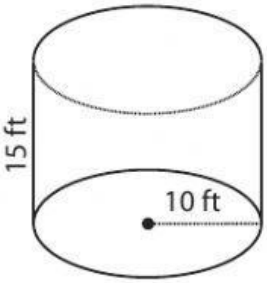

Surface Area = _____

7)

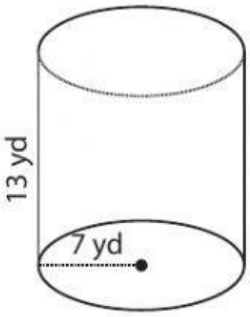

Surface Area = _____

8)

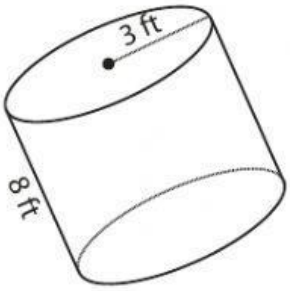

Surface Area = _____

9)

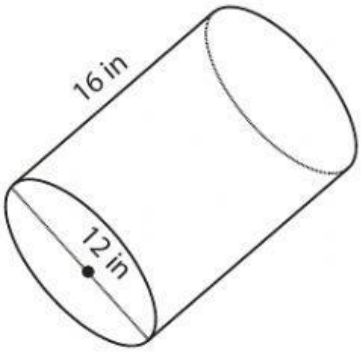

Surface Area = _____

LIVEWORKSHEETS