Republic of the Philippines
Department of Education
NATIONAL CAPITAL REGION
SCHOOLS DIVISION OFFICE OF LAS PIÑAS CITY

NAME: _____	**Score:** _____
GRADE & SECTION _____	**Teacher:** _____

WORKSHEET in MATHEMATICS 4
Third Quarter
Week 4 – Day 1-2

Identifies and describes triangles according to sides and angles (M4GE-IIIc-16)

A. Match Column A with Column B.

A	B
1. Right Triangle	a. A triangle that has three acute angles
2. Isosceles Triangle	b. A triangle that has three equal sides
3. Obtuse Triangle	c. A triangle that has two equal sides
4. Acute Triangle	d. A triangle that has an obtuse angle
5. Equilateral Triangle	e. One of the measures of the angle is 90°

B. Identify the triangles according to sides and angles.

1. 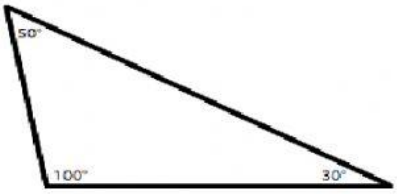

2. 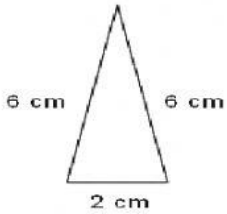

3. 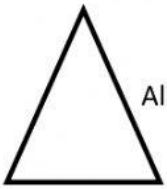
All sides are equal

4. 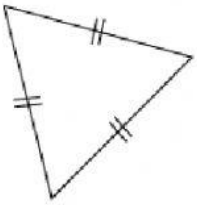

5. 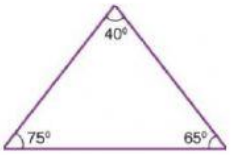

C. Describe each kind of triangle according to sides and angles.

1. Scalene Triangle
2. Equiangular Triangle
3. Right Triangle
4. Isosceles Triangle
5. Acute Triangle

LIVEWORKSHEETS