DECIMALS

Els decimals es poden expresar en forma de fracció:

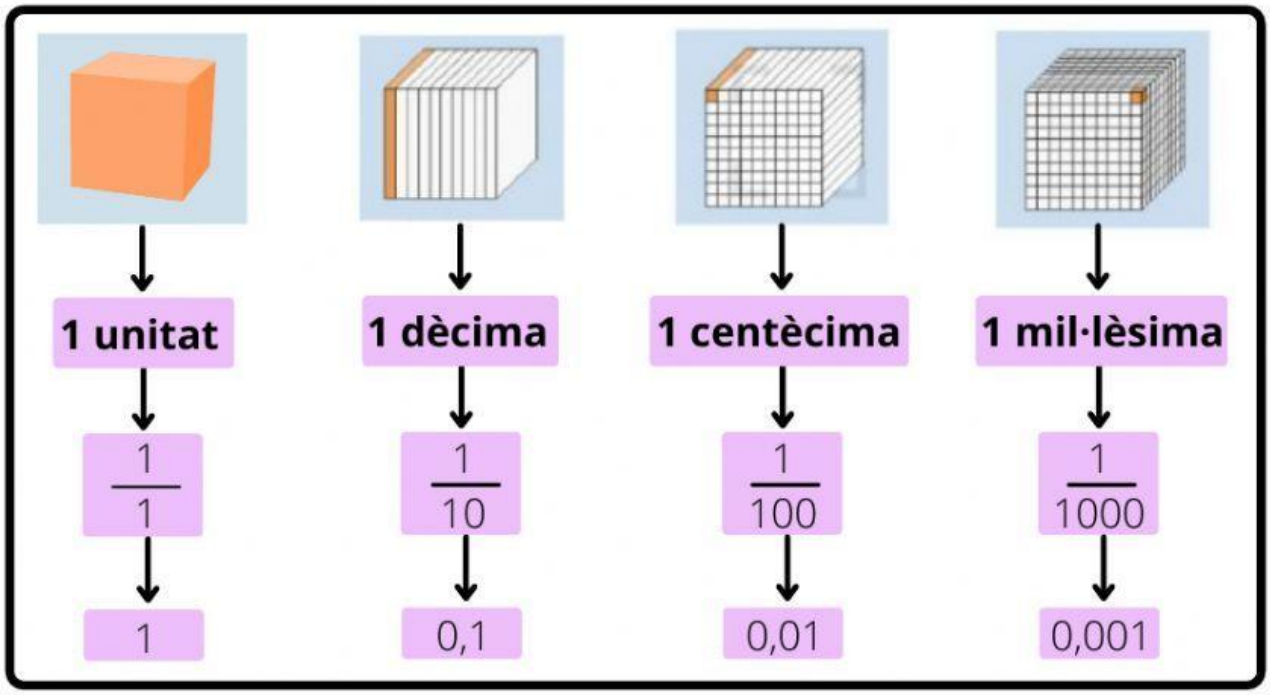

Escriu en forma de decimal:

$\frac{7}{10}$ → ____ $\frac{271}{1000}$ → ____ $\frac{9}{10}$ → ____

$\frac{52}{100}$ → ____ $\frac{2}{10}$ → ____ $\frac{638}{1000}$ → ____

Escriu en forma de fracció:

0,56 → ____ 0,007 → ____ 0,153 → ____

0,8 → ____ 0,45 → ____ 0,2 → ____

LIVEWORKSHEETS

Unix amb fletxes la representació gràfica y la fracció correcponent. Després escriu el número en forma de decimal:

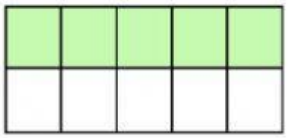

$\frac{9}{10}$ → _____

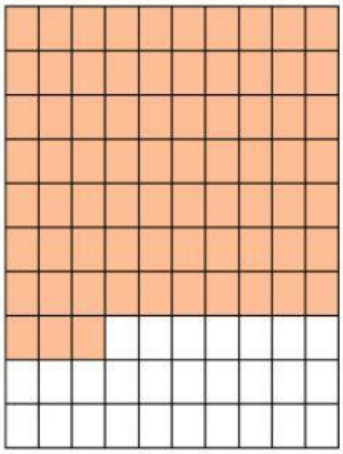

$\frac{27}{100}$ → _____

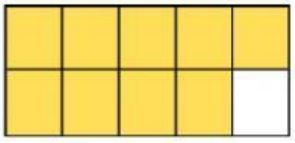

$\frac{73}{100}$ → _____



$\frac{5}{10}$ → _____

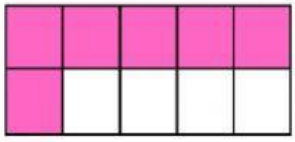

$\frac{6}{10}$ → _____

LIVEWORKSHEETS