What is the Fraction of the Shaded Area ?

1) _____

2) _____

3)  _____

4) _____

5) 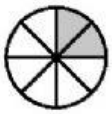 _____

6) _____

7)  _____

8) _____

9) _____

10)

LIVEWORKSHEETS