أستخدم الجمع المتكرر لأجد ناتج الضرب

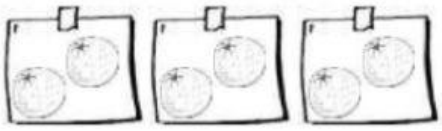

.....+.....+.....=.....

.....× ..... = ...

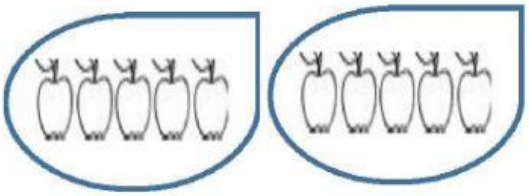

.....+.....=.....

.....× ..... = ...

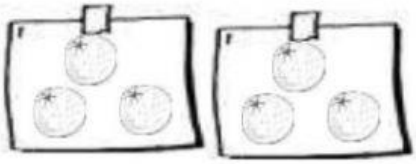

..... + ... =.....

.....× ..... = ...

..... +.....+.....+.....+.....=.....

.....× ..... = ...

أصل بين عملية الجمع المتكرر وعملية الضرب

4 + 4+ 4	5 + 5	3+3+3+3



3+3+3	2+2+2+2+2	1+1+1+1

LIVEWORKSHEETS

الفصل الدراسي الثاني :2021 / 2022

ورقة عمل (2)

أجد عدد العناصر باستخدام عملية الضرب :



[ ] × [ ] = [ ]



[ ] × [ ] = [ ]



[ ] × [ ] = [ ]

كم عدد أرجل 4 طاولات ؟

[ ] + [ ] + [ ] + [ ] = [ ]

[ ] × [ ] = [ ]

كم عجلة ل 5 دراجات هوائية ؟

[ ] + [ ] + [ ] + [ ] + [ ] = [ ]

[ ] × [ ] = [ ]

LIVEWORKSHEETS