ชื่อ ..... ชั้น ป.5/..... เลขที่ .....

ให้นักเรียนหาปริมาตรรูปเรขาคณิตสามมิติด้วยการนับจำนวนลูกบาศก์

1

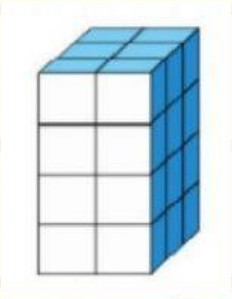

..... ลบ.ซม.

2

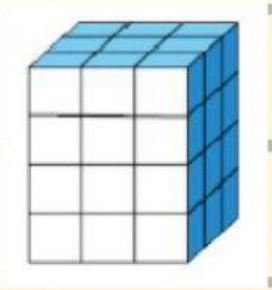

..... ลบ.ซม.

3

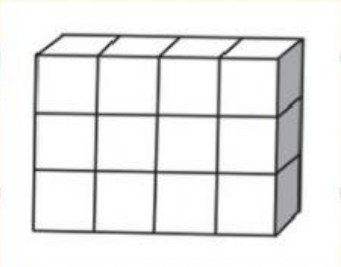

..... ลบ.ซม.

4

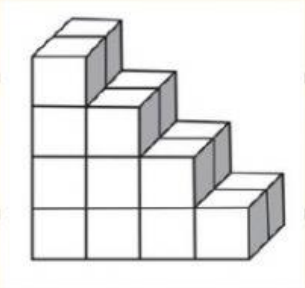

..... ลบ.ซม.

5

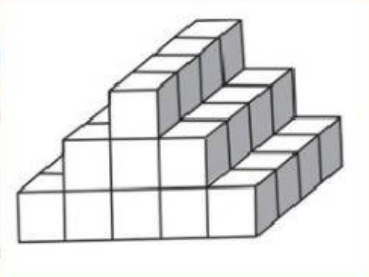

..... ลบ.ซม.



LIVEWORKSHEETS