Name_____ Fractions to Decimals

Write a fraction and a decimal for each picture:



_____=_____



_____=_____



_____=_____



_____=_____



_____=_____



_____=_____

_____=_____



_____=_____



_____=_____

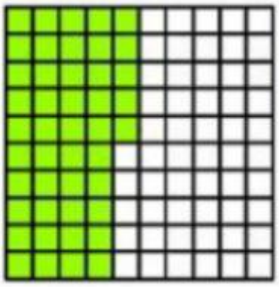

_____=_____



_____=_____



_____=_____

LIVEWORKSHEETS