PHIẾU ÔN TẬP

Bài 1: Số mấy?

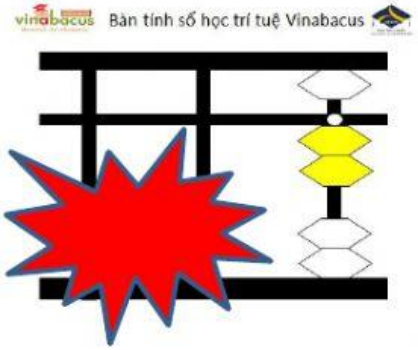

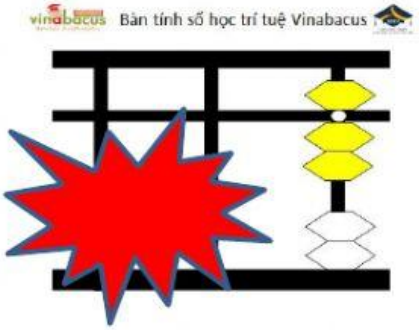

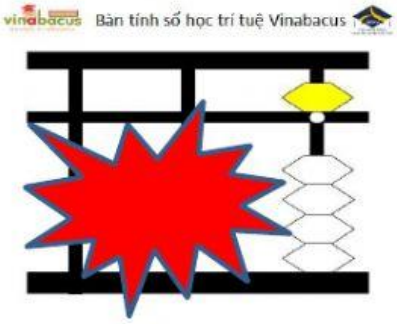

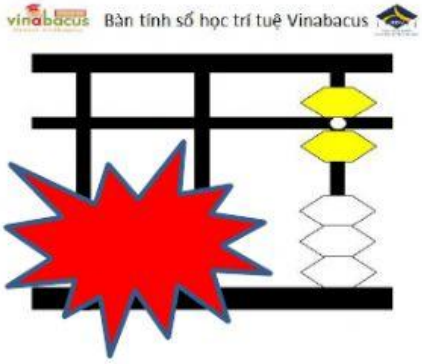

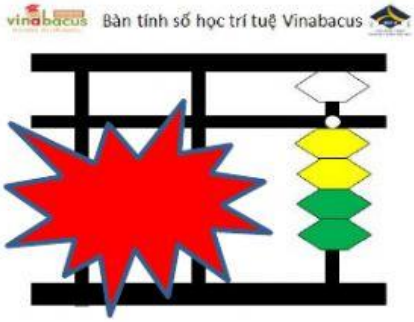



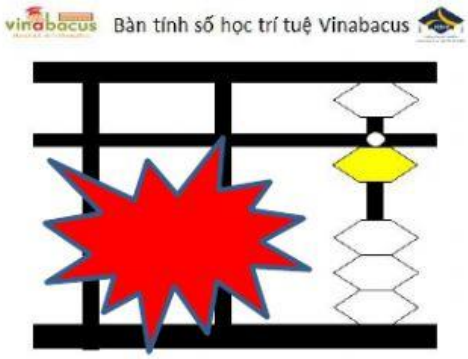

LIVEWORKSHEETS

Bài 2: Thực hiện phép tính

1	2	3	4	5	6	7	8	9	10
3 6 -4	4 -2 6	1 6 -5	3 -2 6	3 6 -2	7 -6 5	8 -6 2	5 4 -6	2 6 -6	7 -6 6

1	2	3	4	5	6	7	8	9	10
4 -1 6	6 3 -6	8 1 -6	7 -6 5	4 -2 6	9 -6 5	7 1 -6	4 -1 6	5 1 -6	8 -6 1

1	2	3	4	5	6	7	8	9	10
2 7 -4	3 -1 7	4 -2 7	9 -7 2	8 1 -7	6 1 -7	7 -7 7	6 3 -7	8 -7 5	1 7 -5

1	2	3	4	5	6	7	8	9	10
7 -5 7	9 -7 6	6 2 -7	1 7 -6	3 6 -7	9 -7 -1	8 1 -6	2 6 -7	8 -7 6	5 3 -7

LIVEWORKSHEETS