Colegio Nourish

2021-2022 **2nd. Grade**

February Exam **Science**

Name: _____ **List #** _____

Date: _____ **Teacher: Jacklenis Salazar**

1. Choose the name of the habitat according to the picture. (1-4)

DESERT FOREST OCEAN WETLAND

2. Choose the word to complete the sentence. (5-7)

food chain predator prey

5. _____ is an animal that catches and eats another animal.

6. _____ is an animal that is caught and eaten.

7. _____ shows how energy passes from one living thing to another.

LIVEWORKSHEETS

3. Drag the picture to the correct column if it is PREY or PREDATOR. (8-11)

PREY	PREDATOR

4. Write 1 to 5 to order the food chain. (12-16)

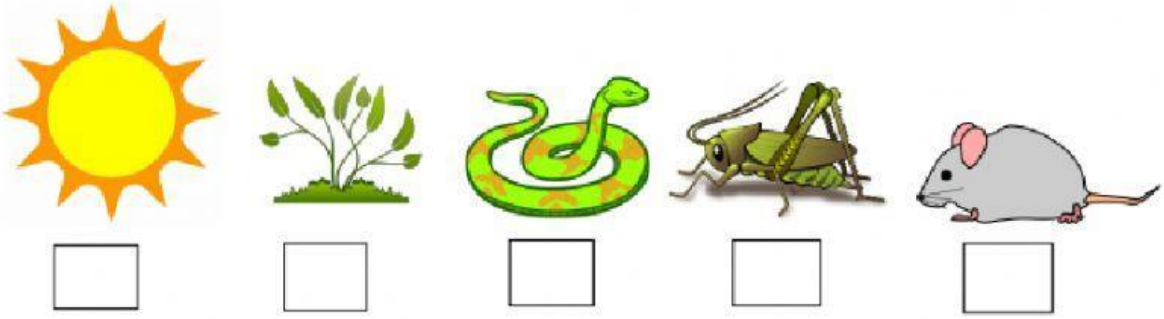

LIVEWORKSHEETS

5. Drag the body parts of this insect. (17-19)

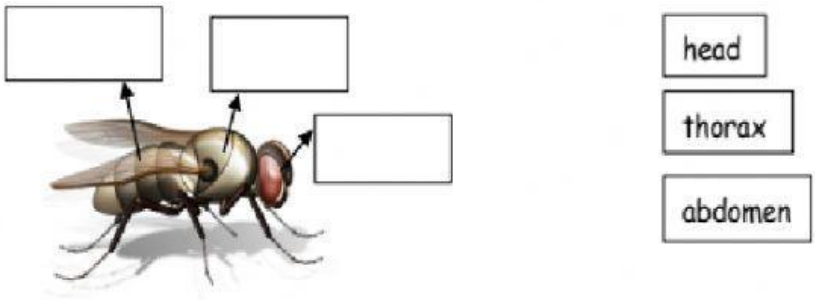

head

thorax

abdomen

6. Label the animals below. (20-26)

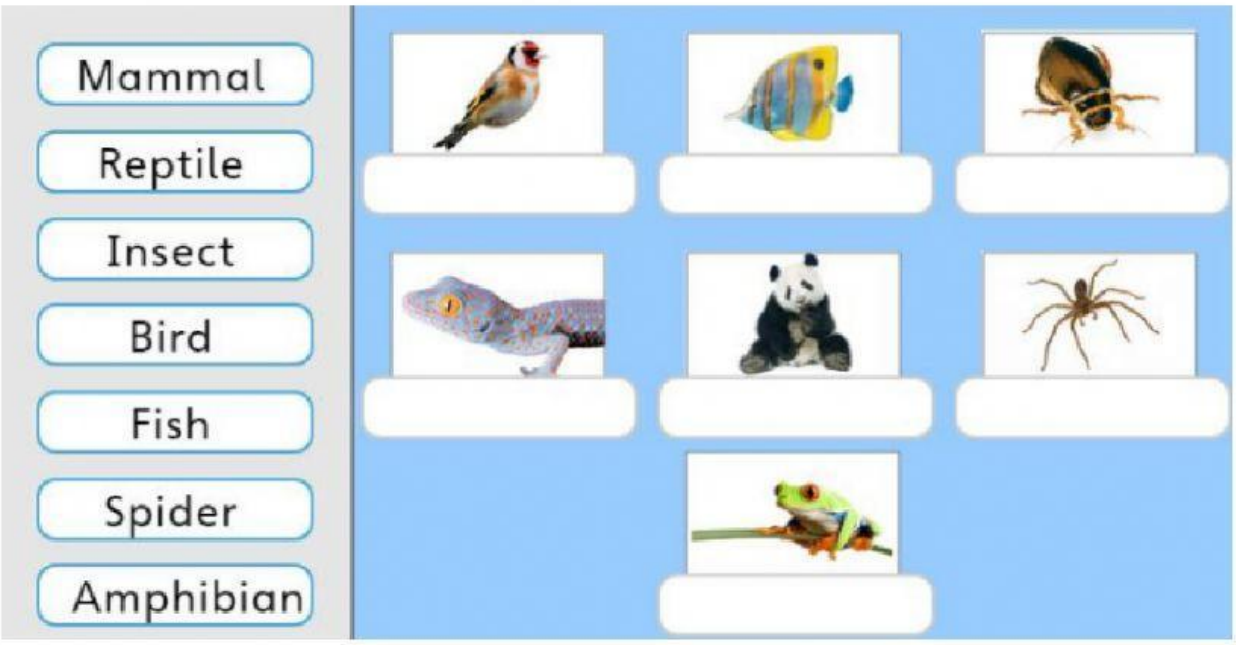

LIVEWORKSHEETS

7. Choose if the sentence is TRUE or is FALSE. (27-28)

Bones help the animals shape, move and grow. TRUE FALSE

Bones protect some body parts. TRUE FALSE

8. Write the corresponding labels for each column. How do the animals protect themselves?

poison | camouflage | Hard body parts

LIVEWORKSHEETS