Estimating Angle

Name:

Solve each problem.

1)

Which choice best represents ?KLM?

A. 95°
B. 41°
C. 19°
D. 151°

2)

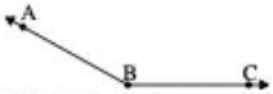

Which choice best represents ?ABC?

A. 62°
B. 151°
C. 90°
D. 9°

3)

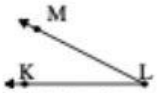

Which choice best represents ?KLM?

A. 94°
B. 27°
C. 140°
D. 177°

4)

Which choice best represents ?KLM?

A. 141°
B. 36°
C. 89°
D. 180°

5)

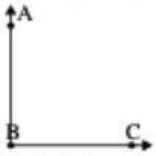

Which choice best represents ?ABC?

A. 90°
B. 6°
C. 130°
D. 44°

6)

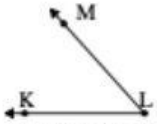

Which choice best represents ?KLM?

A. 93°
B. 48°
C. 150°
D. 127°

7)

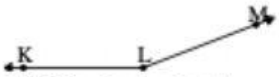

Which choice best represents ?KLM?

A. 54°
B. 159°
C. 97°
D. 21°

8)

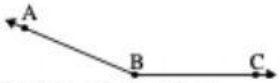

Which choice best represents ?ABC?

A. 157°
B. 72°
C. 26°
D. 127°

9)

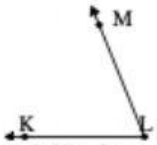

Which choice best represents ?KLM?

A. 173°
B. 110°
C. 137°
D. 68°

Answers

1. _____
2. _____
3. _____
4. _____
5. _____
6. _____
7. _____
8. _____
9. _____

LIVEWORKSHEETS