Weekly Test 6- Mathematics

A. Match the numeral to the word name.

Numeral	Word Name
11	fifteen
12	thirteen
13	fourteen
14	twelve
15	eleven

B. Count the objects and select the correct number.

13 12 11



13 12 11

14 13 11



13 12 11



14 13 15



13 12 11

LIVEWORKSHEETS

C. Solve the following word problems.
Type your number statements.

1. Jaelon had some pens.
Mummy gave him **9** pens. Then he had **15** pens in all.
How many pens did Jaelon have before mummy gave him any?

_____ + 9 = 15

2. There are 11 apples on a tree. 3 apples fell off.
How many apples are left?

_____



3. Amelia has **5** oranges and Saydee has **7** bananas.
How many fruits they have **in all**?

_____

LIVEWORKSHEETS

D. Measure each object using the paper clips.

paper clips

paper clips

paper clips

paper clips

LIVEWORKSHEETS