Instructions: Find the lengths of the missing sides. Then add to find the perimeter of each shape.

1)

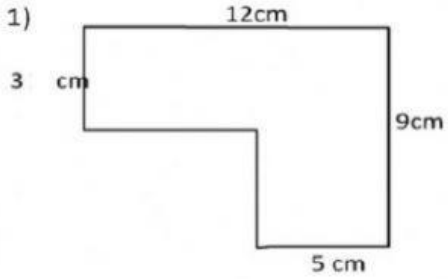

Perimeter = _____ cm

2)

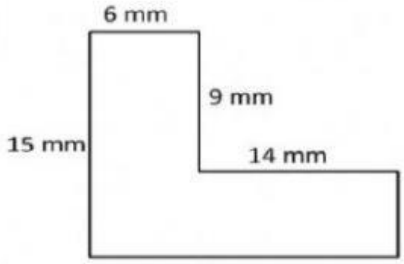

Perimeter = _____ mm

1)

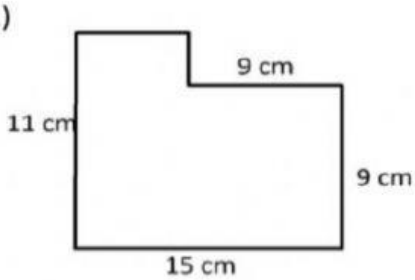

Perimeter = _____ cm

2)

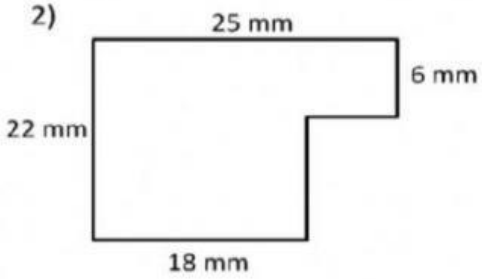

Perimeter = _____ mm

3)

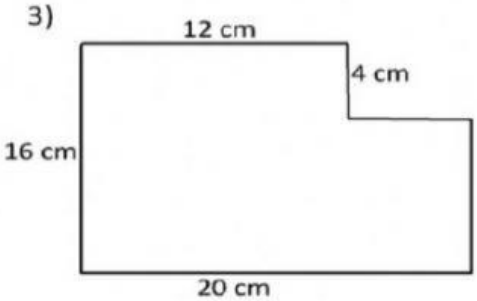

Perimeter = _____ cm

LIVEWORKSHEETS