Name: _____ **Date:** _____

Grade: _____ **Student no.** _____

Grade 2 Mathematics / Day 1

Final test (2nd semester)

Part I: Choose the correct sentence to fill in the pictures. Drag down the sentences below.

- Mary brushes her teeth at 7 am.
- Mary has her lunch at 12 pm.
- Mary likes to do homework at 3 pm.
- Mary brushes her teeth at 8 pm.

1.

3.

2.

4.

Part II: Rearrange the letters to complete the days and colors of the week. Type your answers in the underline or box provided below.

1. u a S d n y _____ is _____red_____
2. o a M y d n _____ is _____
3. u e T s a y d _____ is _____

LIVEWORKSHEETS

4. s a y n d e d e W _____ is _____

5. h r u s T a d y _____ is _____

6. a i r F y d _____ is _____

7. S t a r u y d a _____ is _____

Part III: Look at the circled number on each calendar. Fill in the blanks with the date, month, day and year.

1.

October - 2020						
Sun	Mon	Tue	Wed	Thu	Fri	Sat
				1	2	3
4	5	6	7	8	9	10
11	12	13	14	15	16	17
18	19	20	21	22	23	24
25	26	27	28	29	30	31

Date: _____ Month: _____

Day: _____ Year: _____

3.

March - 2018						
Sun	Mon	Tue	Wed	Thu	Fri	Sat
				1	2	3
4	5	6	7	8	9	10
11	12	13	14	15	16	17
18	19	20	21	22	23	24
25	26	27	28	29	30	

Date: _____ Month: _____

Day: _____ Year: _____

2.

April - 2019						
Sun	Mon	Tue	Wed	Thu	Fri	Sat
	1	2	3	4	5	6
7	8	9	10	11	12	13
14	15	16	17	18	19	20
21	22	23	24	25	26	27
28	29	30				

Date: _____ Month: _____

Day: _____ Year: _____

4.

January - 2020						
Sun	Mon	Tue	Wed	Thu	Fri	Sat
			1	2	3	4
5	6	7	8	9	10	11
12	13	14	15	16	17	18
19	20	21	22	23	24	25
26	27	28	29	30	31	

Date: _____ Month: _____

Day: _____ Year: _____

LIVEWORKSHEETS

Part IV: Comparing volume and capacity. Fill in the blanks in each sentence.

1. The capacity of the bowl is _____.
2. The capacity of the _____ is the most.
3. The capacity of the _____ is the least.
4. The capacity of the jar is _____ than the capacity of the bowl.
5. The capacity of the mug is _____ than the capacity of the bowl.
6. The capacity of the _____ is equal to the capacity of the _____.

Part V: Find the volume and capacity of the following containers.

1.

   Capacity of the measuring jar = _____.

   Volume of the lemonade = _____.

2. 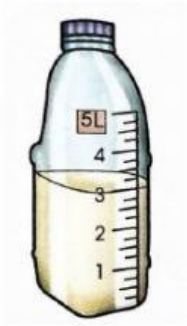

   Capacity of the plastic bottle = _____.

   Volume of milk in the plastic bottle = _____.

LIVEWORKSHEETS

3.

Capacity of the bottle = _____.

Volume of water in the bottle = _____.

4.

Capacity of the water tank = _____.

Volume of water in the water tank = _____.

Part VI: Solve these problems and circle the correct answer.

1. A container can hold 5 cups of orange juice. How many cups of orange juice will there be in 6 such containers?

   a. 11 cups c. 30 cups

   b. 56 cups d. 1 cup

2. A pot holds 30 teaspoons of honey. Mary pours out 11 teaspoons of honey. How much honey is left in the pot?

   a. 41 teaspoons c. 330 teaspoons

   b. 19 teaspoons d. 2r8 teaspoons

Part VII: Write the names of the two-dimensional geometric shapes. Choose your answer from the box.

Quadrilateral	Circle
Ellipse	Triangle

LIVEWORKSHEETS

1. 

3.

2. 

4. 

Part VIII: Write the names of the three-dimensional geometric shapes. Choose your answer from the box.

Cuboid	Cylinder	Sphere

1.

3.

2.

4.

LIVEWORKSHEETS