Lakukan pengurangan pecahan berpenyebut sama untuk soal-soal berikut.

Isilah jawaban pada tempat yang tersedia. Beri warna pada gambar sesuai dengan jawabanmu.

1.

$\square = \square$

$\square - \square$

2. 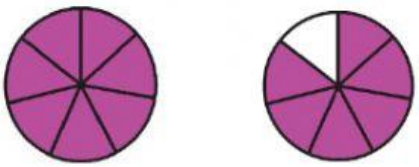

$\square = \square$

$\square - \square$

3. 

$\square = \square$

$\square - \square$

4. 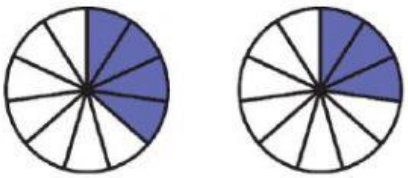

$\square = \square$

$\square - \square$

$\frac{7}{7}$

$\frac{6}{7}$

$\frac{1}{7}$

$\frac{3}{3}$

$\frac{1}{3}$

$\frac{2}{3}$

$\frac{7}{9}$

$\frac{4}{9}$

$\frac{2}{9}$

$\frac{4}{11}$

$\frac{3}{11}$

$\frac{1}{11}$

LIVEWORKSHEETS

Kerjakanlah soal latihan berikut tentang pengurangan pecahan berpenyebut sama.

Tuliskan lambang bilangan pecahan lengkap dengan gambarnya.

1. 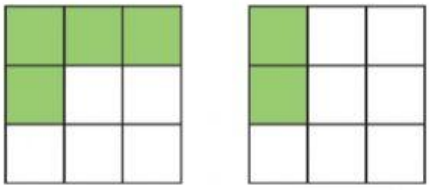 = ☐

☐ - ☐

2. 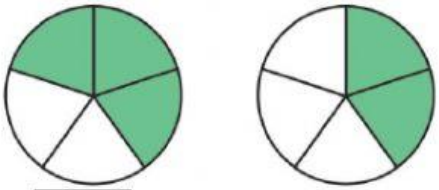 = ☐

☐ - ☐

3. 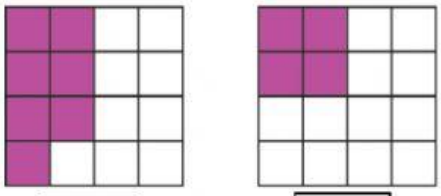 = ☐

☐ - ☐

$\frac{3}{5}$ $\frac{2}{5}$ $\frac{1}{5}$ $\frac{2}{9}$ $\frac{2}{9}$ $\frac{4}{9}$ $\frac{3}{16}$ $\frac{4}{16}$ $\frac{7}{16}$

4. Kerjakan soal berikut tanpa disertai gambar.

a. $\frac{3}{7} - \frac{2}{7} = \square$ $\frac{3}{5}$

b. $\frac{5}{6} - \frac{3}{6} = \square$ $\frac{2}{6}$

c. $\frac{4}{5} - \frac{1}{5} = \square$ $\frac{1}{7}$

LIVEWORKSHEETS