GEOMETRIA 4

Lerro poligonal itxi batek eta haren barrualdeak poligono bat osatzen dute.
Zenbait poligono mota daude. Hauek dira batzuk:

Triangelua

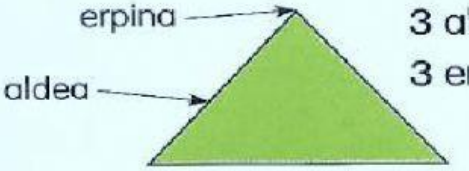

3 alde eta
3 erpin ditu.

Lau-aldekoa

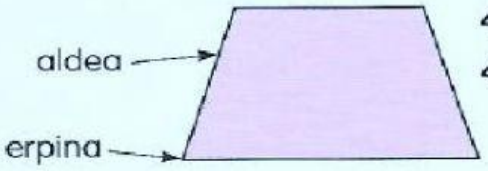

4 alde eta
4 erpin ditu.

Zenbait laukik izen berezia dute.

laukia



laukizuzena

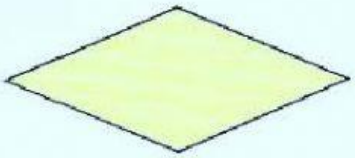

errombOa

1. Idatzi polígono bakoitzaren izena.

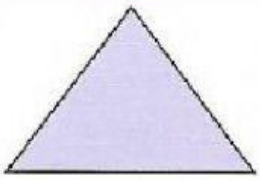

triangelua





2. Hurrengo poligonoen aldeak eta erpinak zenbatu.

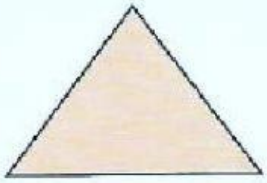

☐ alde
☐ erpin

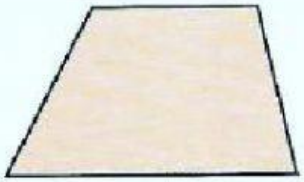

☐ alde
☐ erpin

☐ alde
☐ erpin

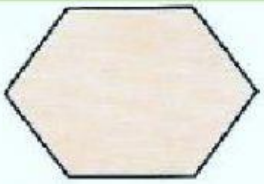

☐ alde
☐ erpin