Measuring Length

Write the correct length.

Caterpillar _____ cm

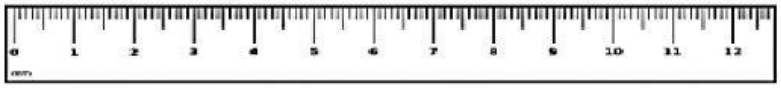

Toy car _____ cm

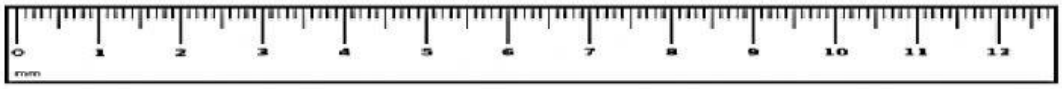

Water Bottle _____ cm

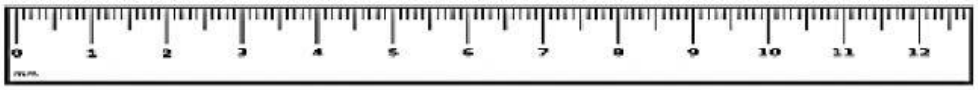

Soda _____ cm

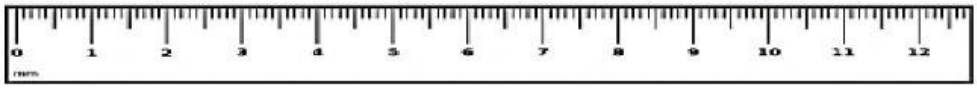

I. What equation can you write to compare the lengths? Fill in the numbers.

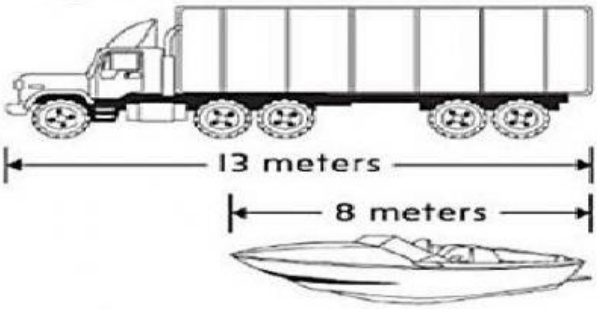

_____ – _____ = _____

The boat is _____ meters _____ than the truck.

LIVEWORKSHEETS