LOS AMIGOS DEL 100

Resuelve las siguientes operaciones ayudándote de la tabla de los amigos del 100.

Si no recuerdas cómo se utiliza, puedes hacer memoria viendo el video de los amigo del 100 en el siguiente enlace:

https://www.youtube.com/watch?v=24TcDOlwyrg.

44 + 41 = _ _

78 + 6 = _ _

50 + 22 = _ _

25 + 15 = _ _

83 + 15 = _ _

31 + 12 = _ _

10 + 24 = _ _

1	2	3	4	5	6	7	8	9	10
11	12	13	14	15	16	17	18	19	20
21	22	23	24	25	26	27	28	29	30
31	32	33	34	35	36	37	38	39	40
41	42	43	44	45	46	47	48	49	50
51	52	53	54	55	56	57	58	59	60
61	62	63	64	65	66	67	68	69	70
71	72	73	74	75	76	77	78	79	80
81	82	83	84	85	86	87	88	89	90
91	92	93	94	95	96	97	98	99	100

Completa los siguiente cruinúmeros.
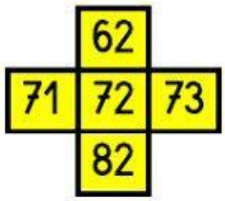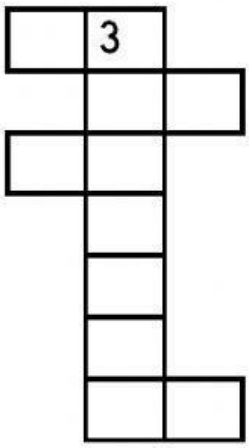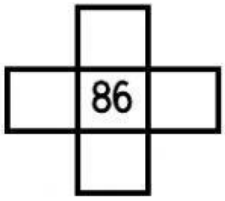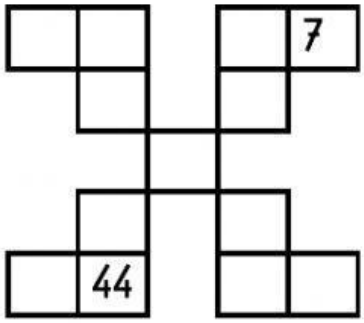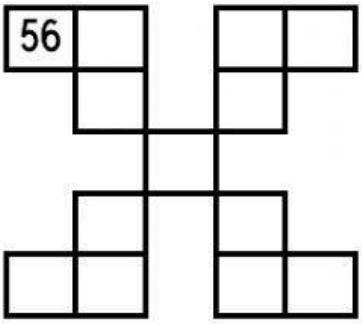
Pista →