Math
Third graders

1. Write the temperatures.

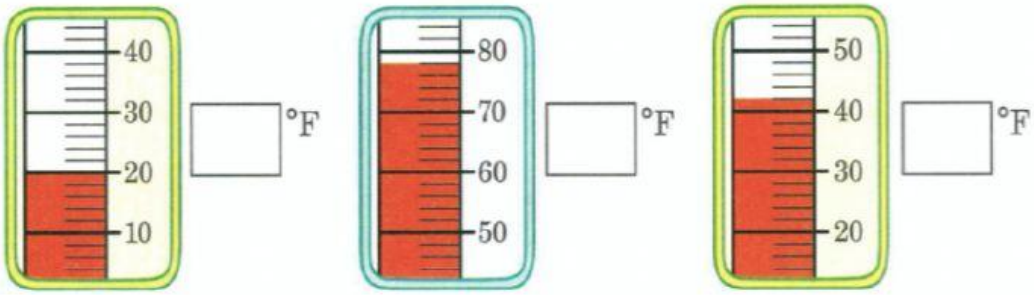

2. Choose the correct sign >, <.

37 ☐ 76	126 ☐ 162	23 ☐ 12	140 ☐ 104
< >	< >	< >	< >

3. How many cents?

1 dime + 5 pennies = _____ ¢

5 dimes = _____ ¢

3 dimes + 4 pennies = _____ ¢

5 nickels = _____ ¢

2 nickels = _____ ¢

2 pennies = _____ ¢

4. Write these numbers in the place-value houses.

	hundreds	tens	ones
143			
67			

	hundreds	tens	ones
205			
39			

5. On Friday, Cody found eight tadpoles. On Saturday, he looked and looked but could not find any. How many tadpoles did he find *altogether* on Friday and Saturday?

☐ + ☐ = ☐ tadpoles



LIVEWORKSHEETS

Combining Dimes and Nickels

10¢ → 20¢ → 30¢ → 35¢ → 40¢ → 45¢

1. How many cents?

☐ ¢ → ☐ ¢ → ☐ ¢ → ☐ ¢ → ☐ ¢ → ☐ ¢ → ☐ ¢

☐ ¢ → ☐ ¢ → ☐ ¢ → ☐ ¢ → ☐ ¢ → ☐ ¢ → ☐ ¢

2. How many dollars?

$ ☐ . → $ ☐ . → $ ☐ . → $ ☐ . → $ ☐ .

$ ☐ . → $ ☐ . → $ ☐ . → $ ☐ . → $ ☐ .

3. Read the pictograph and answer the questions.

Fish Caught in the Summer

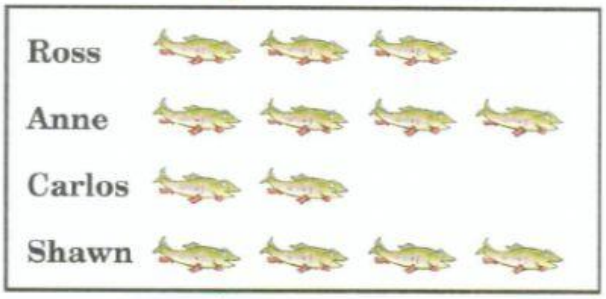

each means 5 fish

a. How many fish did Anne catch? ☐

b. How many fish did the children catch *in all*? ☐

c. *How many more* fish did Anne catch than Carlos? ☐

LIVEWORKSHEETS

1. Write the differences.

9	9	9	9	9	9
− 3	− 5	− 2	− 7	− 4	− 8
___	___	___	___	___	___

9 − 1 = ____ 9 − 0 = ____ 9 − 9 = ____

2. Write the numbers in order.

143	200	155
☐	☐	☐
least	between	greatest

205	131	215
☐	☐	☐
least	between	greatest

3. Count and choose if the circle animals is the half.



YES NO

4. The beavers' den is cozy even when the water in their pond is frozen. What is the freezing point of water? _____°F Color the thermometer to show the freezing point of water.



LIVEWORKSHEETS

1. Write the answers to the combinations your teacher says.

A. _____ B. _____ C. _____ D. _____ E. _____ F. _____

2. How much money?

_____¢ → _____¢ → _____¢ → _____¢ → _____¢ → _____¢

$ ___.___ → $ ___.___ → $ ___.___ → $ ___.___ → $ ___.___ → $ ___.___

3. Write the sums. Add the ones column first. Then add the tens column.

tens	ones
5	0
+ 1	0

tens	ones
1	5
+ 2	0

tens	ones
3	0
+ 4	8

tens	ones
2	5
+ 6	2

4. Write the sums.



3		
2	1	0
	5	4
+1	+2	+4

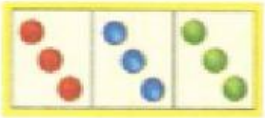

3 + 3 + 3 = ____

6 + 1 + 1 = ____

1 + 3 + 1 = ____

5. Mother heron had four eggs in her nest.
Mother duck had nine eggs in her nest.
How many more eggs did Mother duck have than Mother heron? _____ eggs

LIVEWORKSHEETS