Nickname: _____ Quiz – Second Semester

Match the shapes to their names.

Square

Rectangle

Rhombus

Trapezoid

Parallelogram

Kite

LIVEWORKSHEETS

Perimeter of a Quadrilateral

Find the perimeter of each quadrilateral.

1)

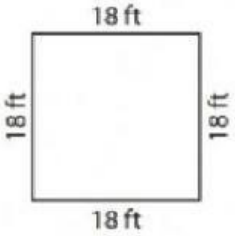

Perimeter = _____

2)



Perimeter = _____

3)

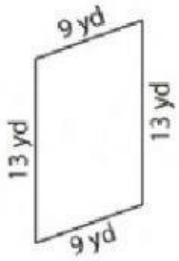

Perimeter = _____

4)

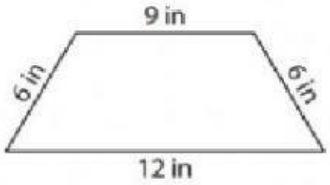

Perimeter = _____

5)

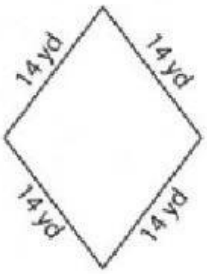

Perimeter = _____

6)

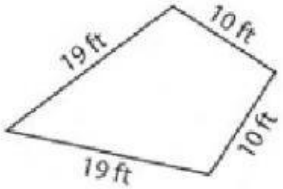

Perimeter = _____

7)



Perimeter = _____

8)

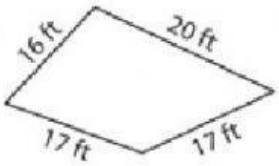

Perimeter = _____

9)

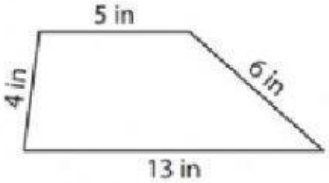

Perimeter = _____

LIVEWORKSHEETS

Find the area of the quadrilateral.

Name

1.

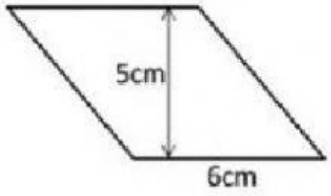

Area:_____ cm^2

2.

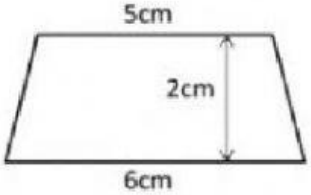

Area:_____ cm^2

3.

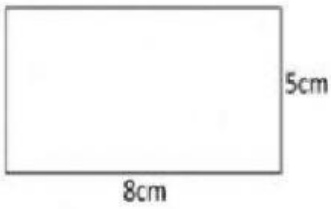

Area:_____ cm^2

4.

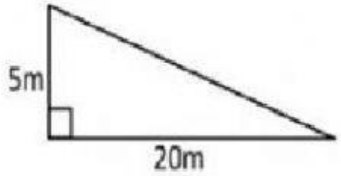

Area:_____ m^2

5.

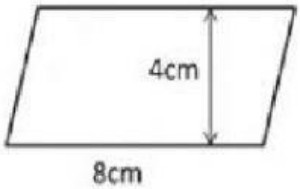

Area:_____ cm^2

6.

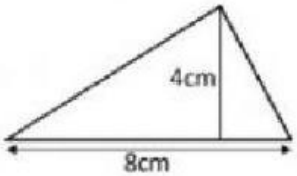

Area:_____ cm^2

7.

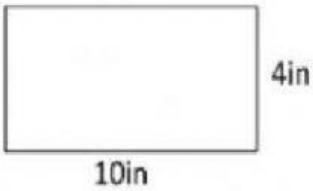

Area:_____ in^2

8.

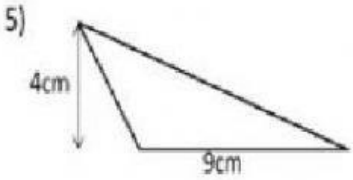

Area:_____ cm^2

9.

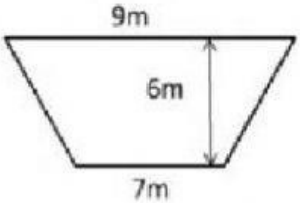

Area:_____ m^2

LIVEWORKSHEETS