REPRESENTACIÓ DE MULTIPLICACIONS

★ Indica quantes **files i columnes** hi ha en cada cas. A més, digues quina **multiplicació** representa:



___ files i ___ columnes

____ x ____= ____



___ files i ___ columnes

____ x ____= ____



___ files i ___ columnes

____ x ____= ____



___ files i ___ columnes

____ x ____= ____

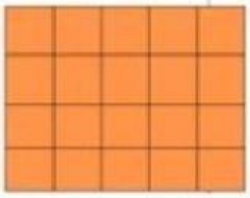

___ files i ___ columnes

____ x ____= ____

___ files i ___ columnes

____ x ____= ____



___ files i ___ columnes

____ x ____= ____



___ files i ___ columnes

____ x ____= ____



___ files i ___ columnes

____ x ____= ____



___ files i ___ columnes

____ x ____= ____

LIVEWORKSHEETS