Stačiakampio plotas



Stačiakampio plotas lygus stačiakampio ilgio ir pločio sandaugai, t. y.
$S = a \cdot b$.

1. Vieno kvadratėlio plotas lygus 1 cm^2. Koks pavaizduoto stačiakampio plotas? Įrašykite į debesėlį reikiamą skaičių.

a)

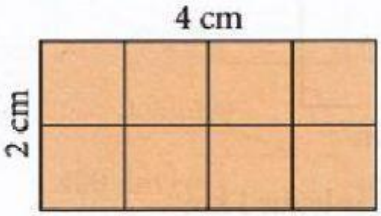

b)

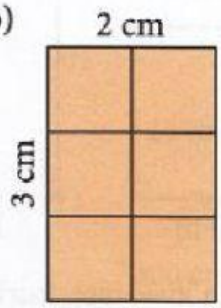

c)

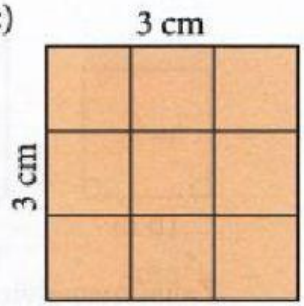

a) ☁ cm^2; b) ☁ cm^2; c) ☁ cm^2.

2. Apskaičiuokite pavaizduoto stačiakampio plotą.

a)



$S = 2\ cm \cdot 4\ cm =$

$= \ldots\ldots\ cm^2$

b)



$S = \ldots\ldots\ cm \cdot \ldots\ldots\ cm =$

$= \ldots\ldots\ cm^2$

c)

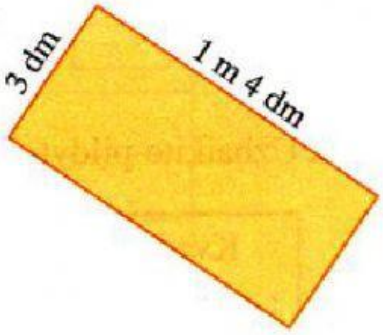

$S = \ldots\ldots\ dm \cdot \ldots\ldots\ dm =$

$= \ldots\ldots\ dm^2$

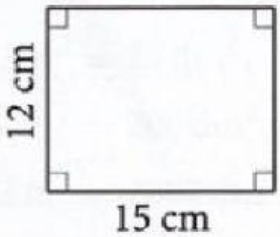

Užrašykite sprendimą.

Ats.: cm^2

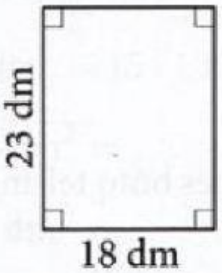

Užrašykite sprendimą.

Ats.: dm^2

LIVEWORKSHEETS

3. 1) Apskaičiuokite kiekvieno pavaizduoto stačiakampio plotą.

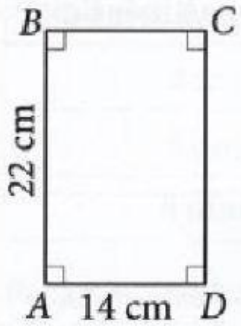



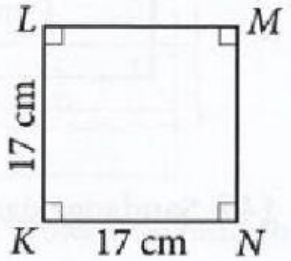

Užrašykite sprendimą.	Užrašykite sprendimą.	Užrašykite sprendimą.
Ats.: cm^2	Ats.: cm^2	Ats.: cm^2

2) Kurio stačiakampio plotas yra:

didžiausias? ABCD EFGH KLMN

mažiausias? ABCD EFGH KLMN

4. Apskaičiuokite pavaizduoto stačiakampio kraštinės, pažymėtos klaustuku, ilgį, kai žinomas kitos kraštinės ilgis ir stačiakampio plotas *S*.

a)

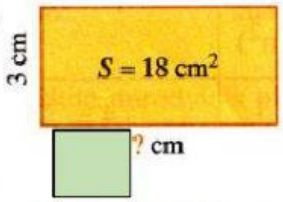

b)

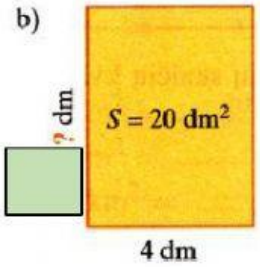

c)

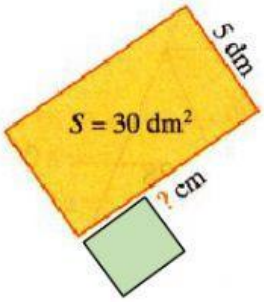

d)

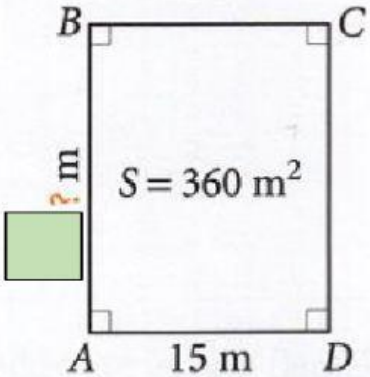

e)

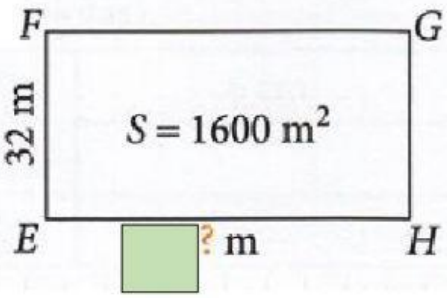

LIVEWORKSHEETS