NUMERACIÓ

Compta les barretes i completa com l'exemple.

2 C 4 D 5 U = 200 + 40 + 5 = 245

- Dos-cents quaranta-cinc



C D U = + + =

C D U = + + =



C D U = + + =

C D U = + + =

C D U = + + =



C D U = + + =

C D U = + + =