Nama :

Absen :

Kelas :

TEOREMA PYTHAGORAS

A. PERHATIKAN VIDEO BERIKUT INI!

B. ISIAN SINGKAT

1. Diketahui segitiga siku-siku ABC, dengan siku-siku di C. Bagaimana rumus mencari hipotenusanya...

2. Sebuah segitiga siku-siku KLM, apabila KL adalah sisi miring. Maka letak siku-sikunya ada di titik ...

C. DROP DOWN

Pilihlah jawaban yang tepat dan benar di bawah ini!

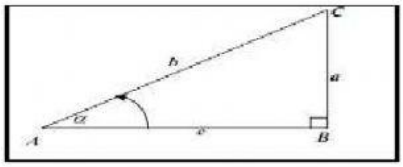

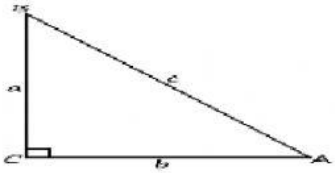

D. JOIN ARROW

Gambarlah garis, dan cocokkan gambar dengan jawaban yang tepat!

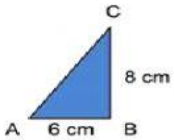

AC =15

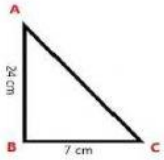

AC =10

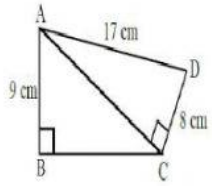

AC =25

LIVEWORKSHEETS

E. DRAG AND DROP

Pindahkan gambar ke kotak kuning sesuai dengan penjelasan yang benar.

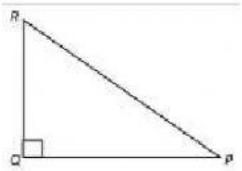

Segitiga siku-siku dengan siku-siku di P

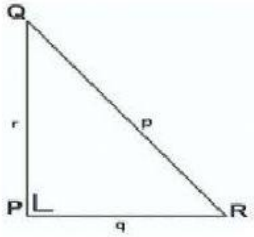

Bukan merupakan segitiga siku-siku

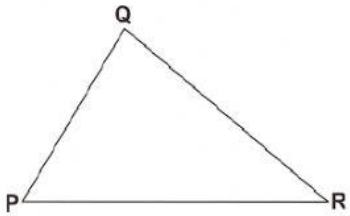

Segitiga siku-siku dengan siku-siku di Q

LIVEWORKSHEETS