القاطع والمماس وقياس الزوايا

الاسم :

تمرين موجه١ أوجد قيمة x.

1A.

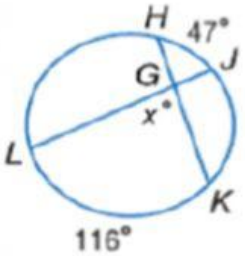

$m\angle LGK = \frac{1}{2}(m\overset{\frown}{\quad} + m\overset{\frown}{LK})$

$m\angle x = \frac{1}{2}(47 + \quad)$

$m\angle x =$

1B.

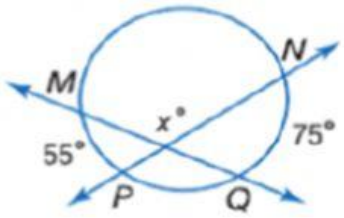

$m\angle MXP = \frac{1}{2}(m\overset{\frown}{NQ} + m\overset{\frown}{\quad})$

$m\angle MXP = \frac{1}{2}(\quad + 55)$

$m\angle MXP =$

$m\angle x = (180 - \quad) =$

1C.

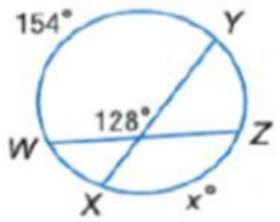

$m\angle YAW = \frac{1}{2}(m\overset{\frown}{WY} + m\overset{\frown}{XZ})$

$128 = \frac{1}{2}(\quad + x)$

$= (154 + x)$

$m\angle x = \quad °$

LIVEWORKSHEETS