hoạt động **1** Số ?

a)

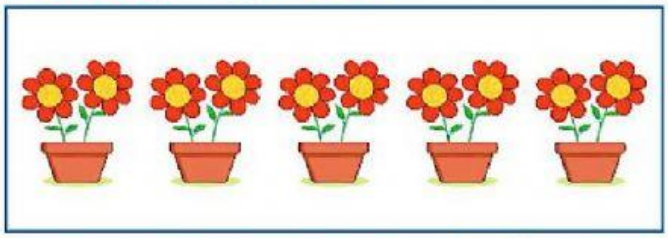



2 + 2 + 2 + 2 + 2 = ☐

2 × ☐ = ☐

5 + 5 = ☐

5 × ☐ = ☐

b)

3 × 5 = ☐ + ☐ + ☐ + ☐ + ☐ = ☐

5 × 3 = ☐ + ☐ + ☐ = ☐

3 × 5 = ☐

5 × 3 = ☐

LIVEWORKSHEETS

hoạt động

2 Tìm phép nhân thích hợp.

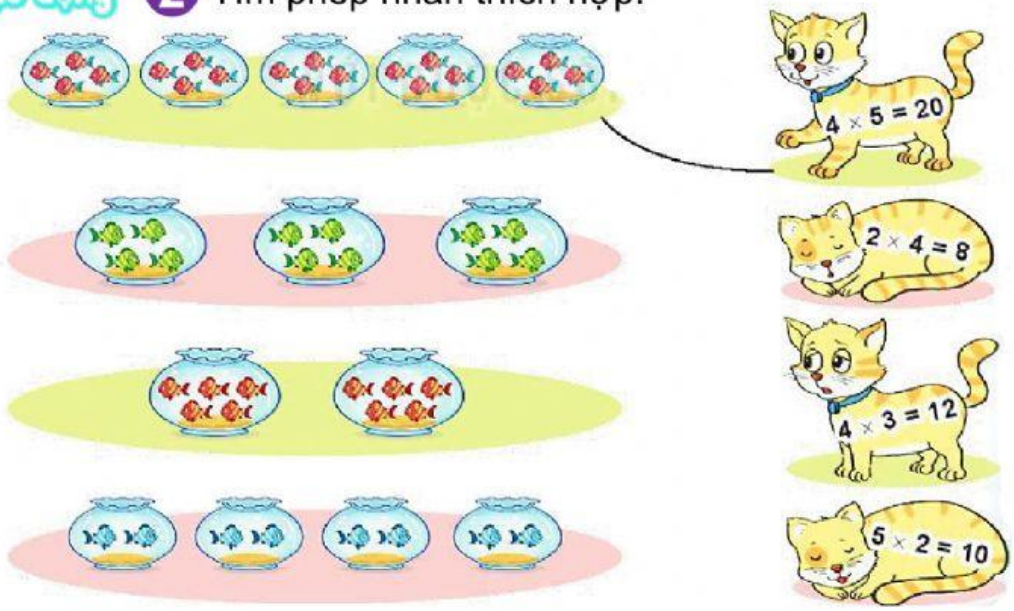

LIVEWORKSHEETS