AREA AND PERIMETER WORKSHEET

Write the area and perimeter of each figure

Area = length x breadth	Perimeter = 2 x (length + breadth) or = length + breadth + length + breadth

1)



AREA = _____ sq.cm

PERIMETER = _____ cm

2)

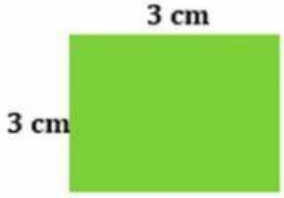

AREA = _____ sq.cm

PERIMETER = _____ cm

3)



AREA = _____ sq.cm

PERIMETER = _____ cm

4)

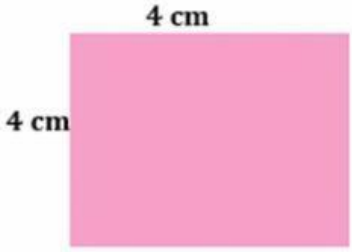

AREA = _____ sq.cm

PERIMETER = _____ cm

5)



AREA = _____ sq.cm

PERIMETER = _____ cm

LIVEWORKSHEETS