ชื่อ.....ชั้น.....เลขที่.....

## แบบฝึกหัด 3.4

**จากโครงสร้างที่กำหนดให้ จงระบุว่าสารแต่ละชนิดต่อไปนี้สามารถละลายน้ำได้หรือไม่ เพราะเหตุใด**

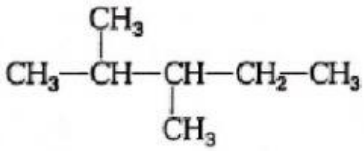

(1)

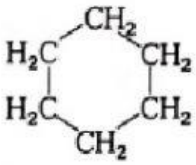

(2)

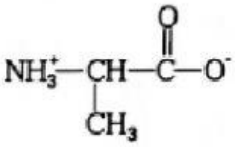

(3)

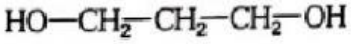

(4)

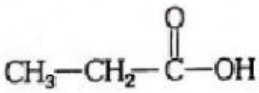

(5)

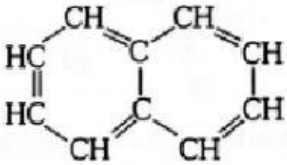

(6)

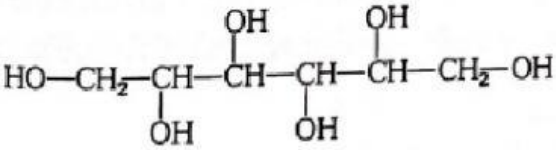

(7)

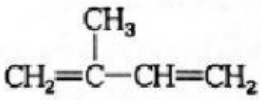

(8)

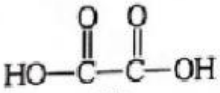

(9)

LIVEWORKSHEETS