Name: _____

Determine whether each function is *one-to-one*, *onto*, *both*, or *neither*.

7.

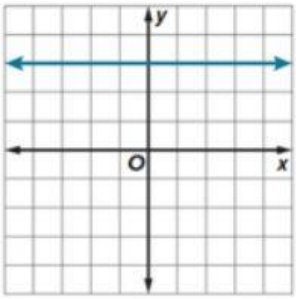

A. one-to-one
B. Onto
C. Both
D. Neither

8.

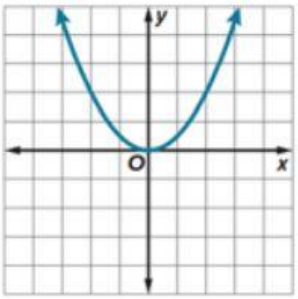

A. one-to-one
B. Onto
C. Both
D. Neither

9.

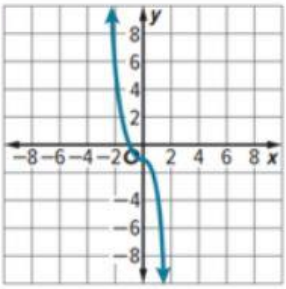

A. one-to-one
B. Onto
C. Both
D. Neither

LIVEWORKSHEETS