Cambridge Assessment International Education

Cambridge International School

Cambridge Primary Programme

CAMBRIDGE PRIMARY MATHEMATICS 1

REVISION 2

Name: _____ Date: _____ Class: _____

Part 1. Look, read and match.

five

two

three

eight

one

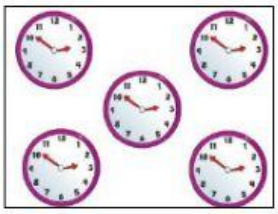



LIVEWORKSHEETS

six



seven



nine



ten



Part 2. Write the number that comes after.





Part 3. Write the number that comes before.





LIVEWORKSHEETS

Part 4. Write the number that comes between.



Part 5. Look, read and tick (✓) the box.

1. Which is taller?



2. Which is shorter?



3. Which is longer?

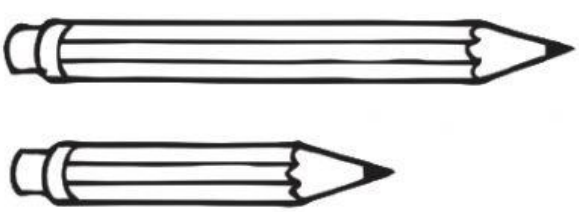

4. Which is the tallest?



5. Which is the smallest?



LIVEWORKSHEETS

5. Which is the longest?

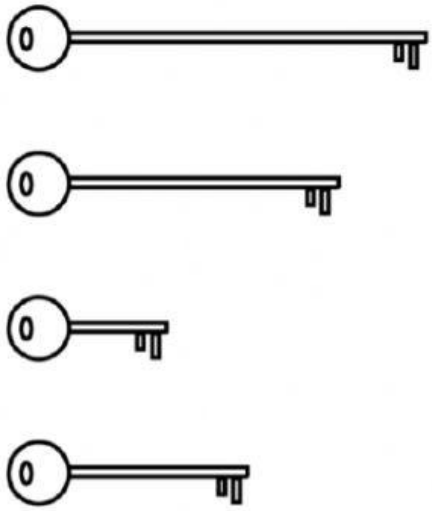

6. Which is the shortest?

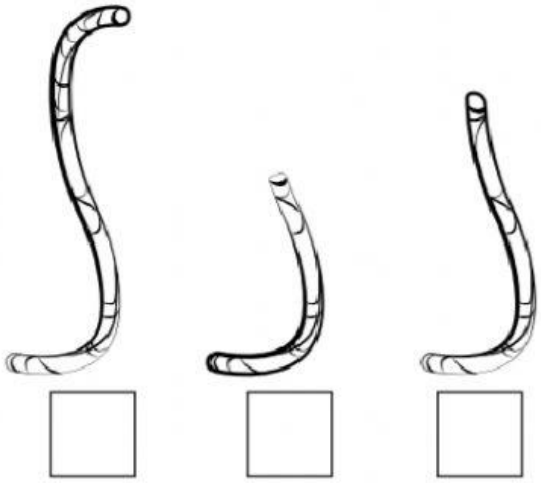

Part 6. Split these numbers into tens and ones.

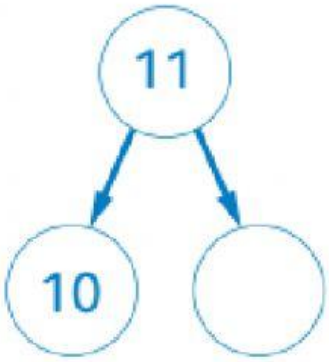

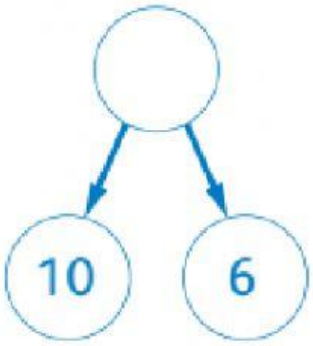

11 is made of ten and ____ ones.

____ is made of ten and 6 ones.

LIVEWORKSHEETS

Part 7. Look and fill in the missing numbers.



Double 4 makes _____ .



Double 3 makes _____ .

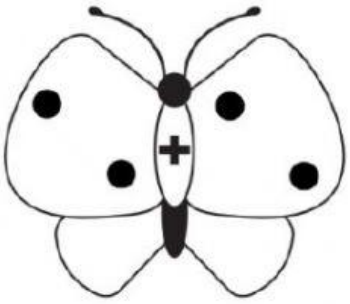

Double 2 makes _____ .



Double 6 makes _____ .

Part 8. Fill in the missing numbers to find the number pairs to 6.

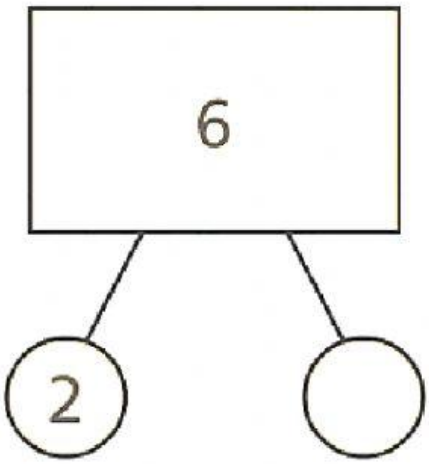

2 and _____ is a number pair to 6.

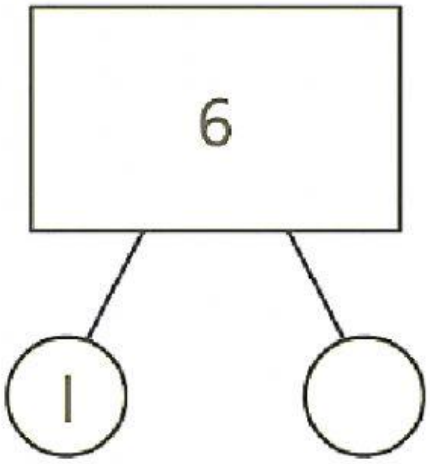

1 and _____ is a number pair to 6.

LIVEWORKSHEETS